Roman Arquitecture

1. Write the name of the monuments under the picture.

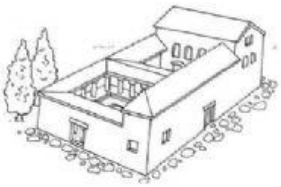

_____ _____ _____ _____ _____



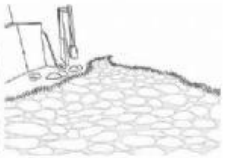

_____ _____ _____ _____ _____

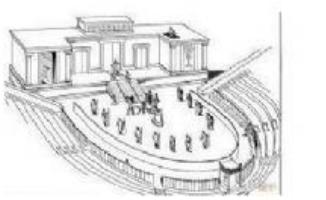

_____ _____ _____ _____

LIVEWORKSHEETS