Identifying Quadratic Graphs

Match the equations with the corresponding graph. Just drag the equation to the bottom right corner of the graph.

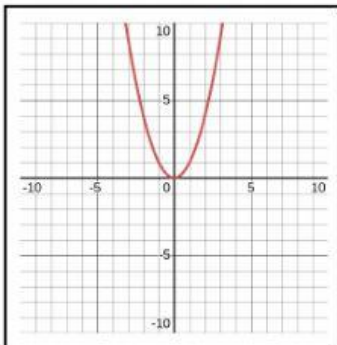	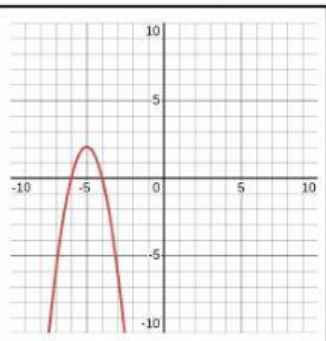	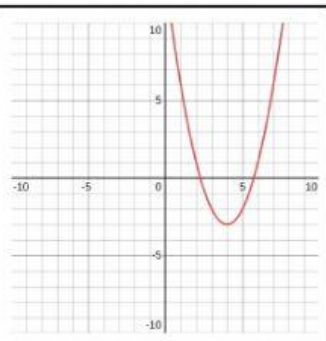	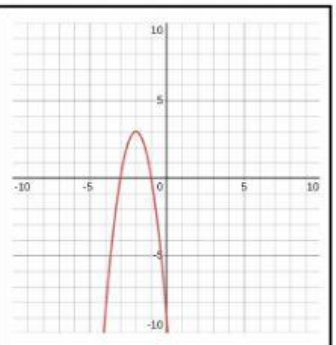
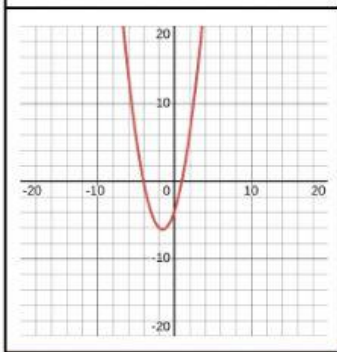	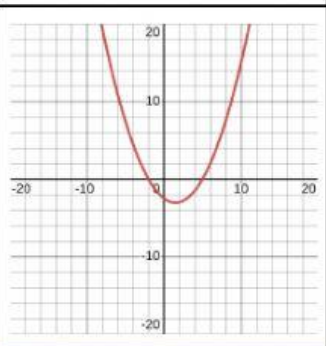	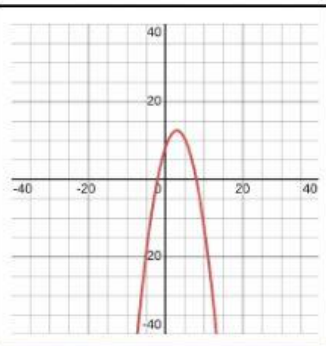	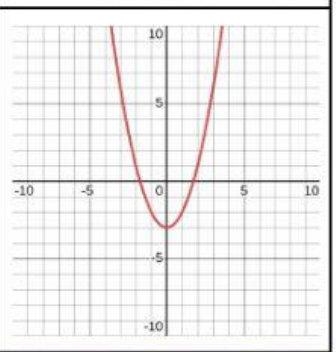
$y = -2(x + 4)(x + 6)$	$y = x^2 - 3$	$y = -3(x + 2)^2 + 3$	$y = (x - 4)^2 - 3$
$y = x^2$	$y = x^2 + 3x - 4$	$y = -\frac{1}{2}x^2 + 3x + 8$	$y = \frac{1}{4}(x + 2)(x - 5)$

LIVEWORKSHEETS