Cambridge Assessment International Education

Cambridge International School

Cambridge Primary Programme

CAMBRIDGE PRIMARY MATHEMATICS 1

UNIT 27-28

ADDITION, SUBTRACTION & NUMBER LINE

Name: _____ Date: _____ Class: _____



total

6 + 4 + 8 = 18

altogether

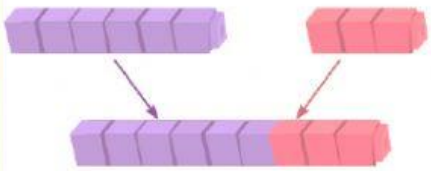

6 + 3 = 9

left

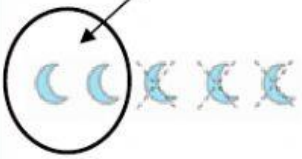

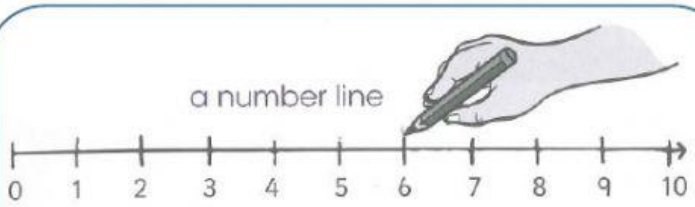

find the difference



The difference between 5 and 3 is 2.

5 – 3 = 2

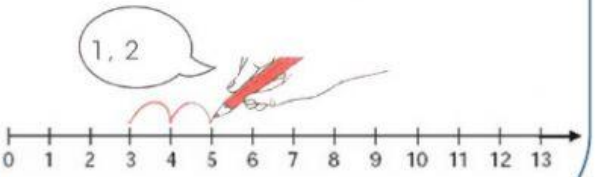

LIVEWORKSHEETS



1. What is the total for each group?

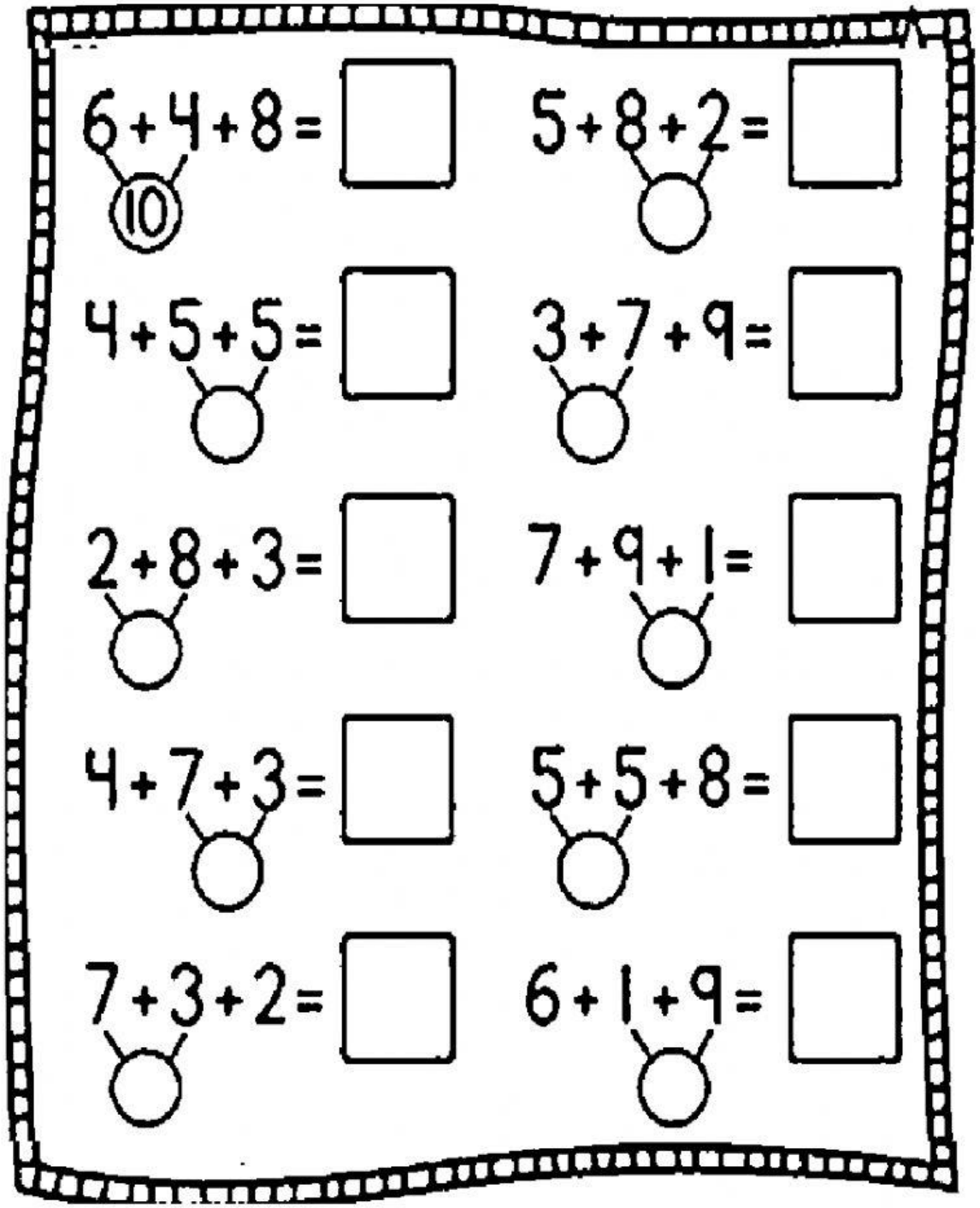

LIVEWORKSHEETS

2. Write the missing numbers using the number line.

Examples



1 + 2 = 3

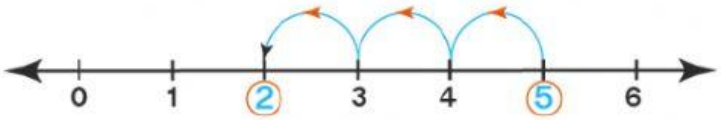

5 - 3 = 2

8 + 5 = ☐

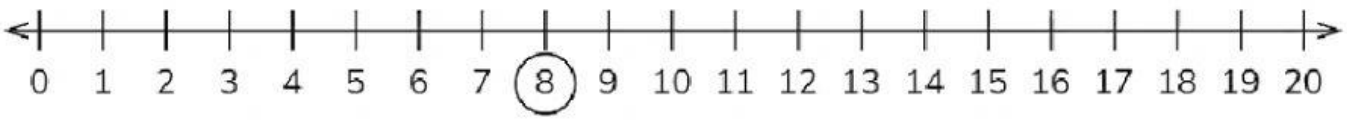

11 + 3 = ☐

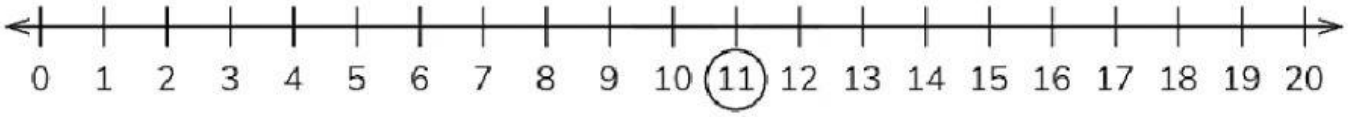

17 − 6 = ☐

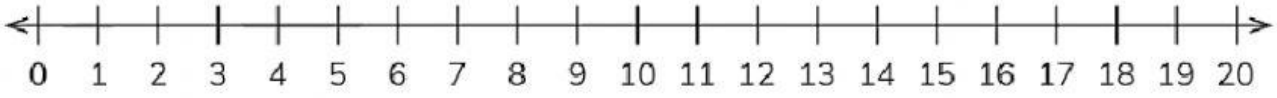

13 − 8 = ☐

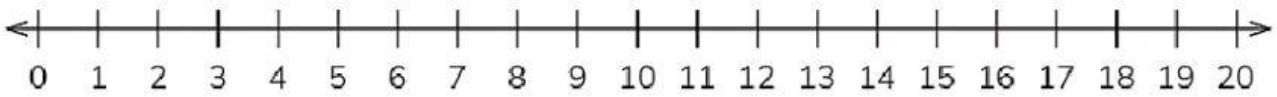

LIVEWORKSHEETS

3. Find the difference using the number line.

Example

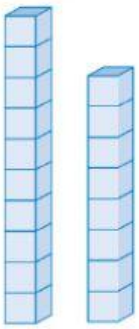

10 – 8 = 2

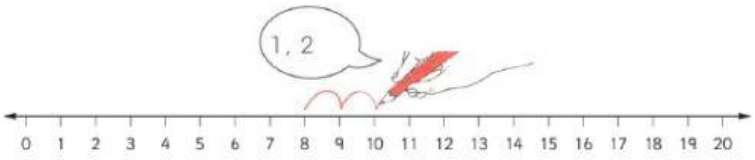

The difference between 10 and 8 is **2** .

(a)

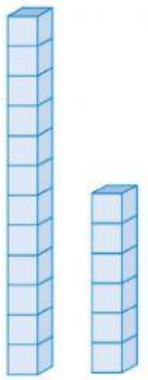

12 – 6 = ☐



The difference between 12 and 6 is _____ .

(b)

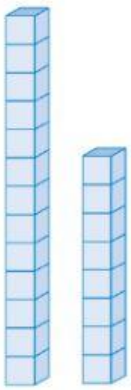

13 – 8 = ☐



The difference between 13 and 8 is _____ .

LIVEWORKSHEETS

(c)

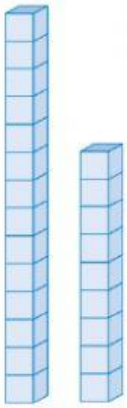

14 – 9 = ☐



The difference between 14 and 9 is _____ .

4. Solve these word problems.

(a) Tom has 3 red toy cars and 5 blue toy cars. How many toy cars is this altogether?





☐ + ☐ = ☐

(b) There are 10 birds. If 4 birds fly away, how many are left?



☐ – ☐ = ☐

(c) There are 7 yellow flowers and 6 red flowers in the garden. How many flowers are there in total?





☐ + ☐ = ☐

(d) There are 8 worms. If the bird eats 3 worms, how many are left?

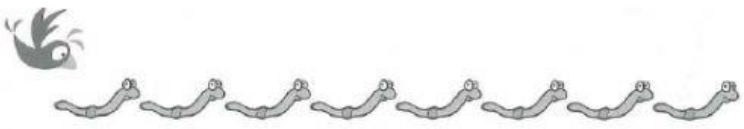

☐ – ☐ = ☐

LIVEWORKSHEETS