CAMBRIDGE PRIMARY MATHEMATICS 2

UNIT 1 – UNIT 8

Name: _____ **Date:** _____ **Class:** _____

1. Circle all pairs that make 10. There is one example for you.

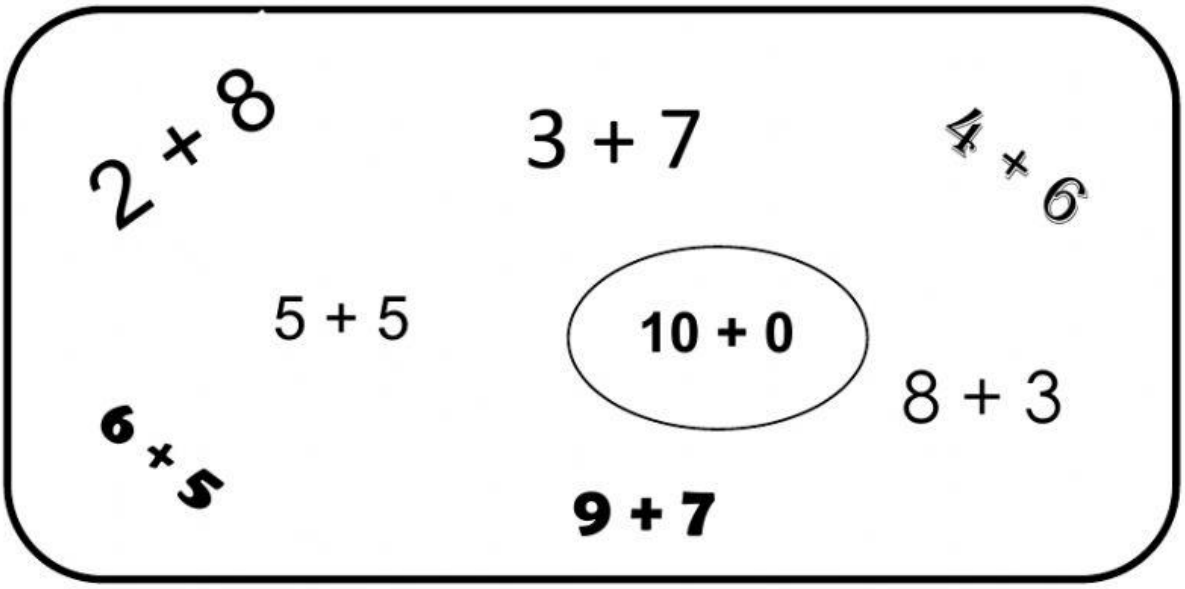

2. Fill in the clouds to make number pairs to 20.

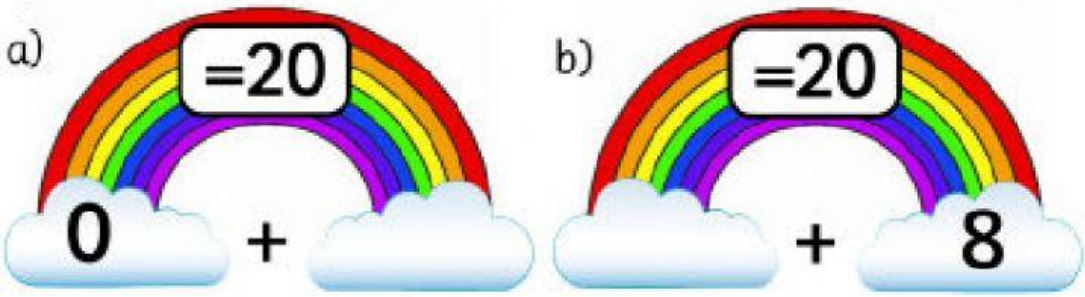

3. Complete the fact family triangles.

LIVEWORKSHEETS

4. Count in fives.

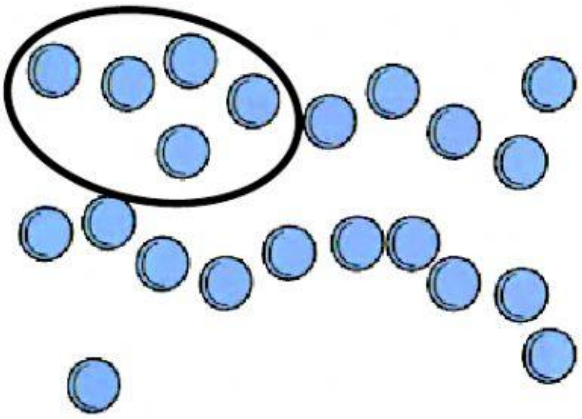

Answer:

5 , _____, _____, _____,_____

There are _____ counters.

5. Circle the midpoint number in the set.

a. 2, 3, 4, 5, 6, 7, 8, 9, 10

b. 13, 15, 17, 19, 21, 23, 24

LIVEWORKSHEETS