اسم الطالبة :-

ورقه عمل درس الزوايا المحيطه (١)

=30 (✓) (✗)	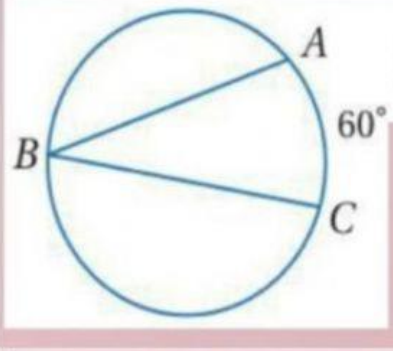	(1 $m\angle B$
=273 (✓) (✗)	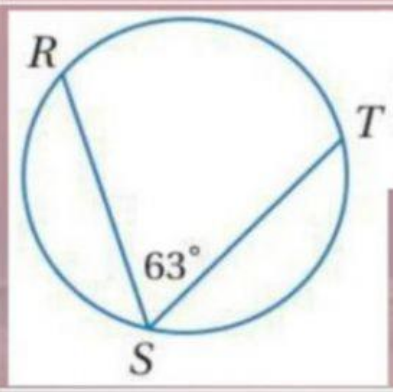	(2 $m\widehat{RT}$
=67 (✓) (✗)	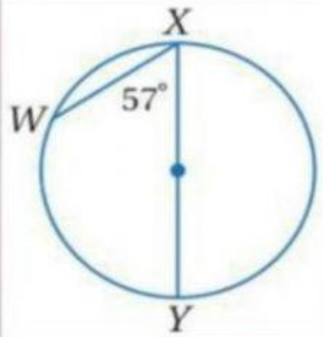	(3 $m\widehat{WX}$
=84 (✓) (✗)	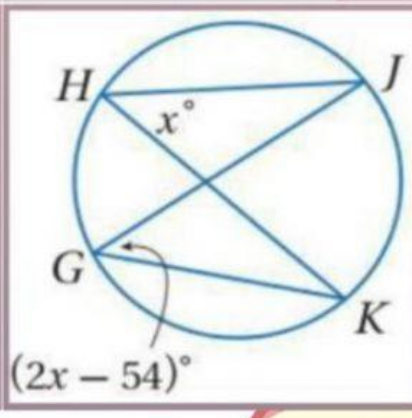	(5 $m\angle H$

rawpixel
LIVEWORKSHEETS