COLEGIO SAN AGUSTIN
EL PARAISO

Caracas, _____ de _____de 20_____.
Quinto grado sección _____.
Nombres y apellidos: _____ N.º____
Área: Matemática Tema: Área y perímetro de polígonos

Ficha didáctica #4

1. Halla el área y perímetro de los siguientes polígonos:

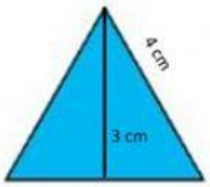

P = ____ cm
A = ____ cm²

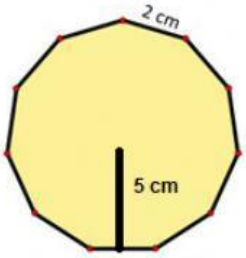

P = ____ cm
A = ____ cm²

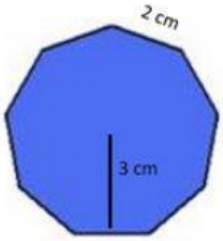

P = ____ cm
A = ____ cm²

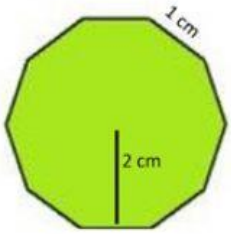

P = ____ cm
A = ____ cm²

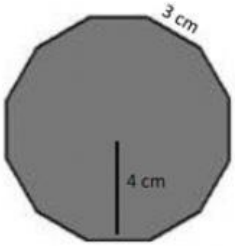

P = ____ cm
A = ____ cm²

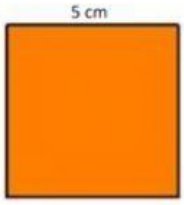

P = ____ cm
A = ____ cm²

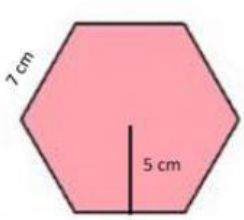

P = ____ cm
A = ____ cm²

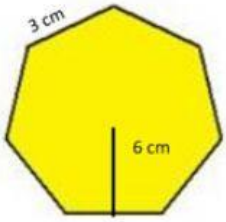

P = ____ cm
A = ____ cm²

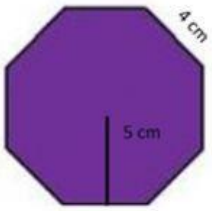

P = ____ cm
A = ____ cm²

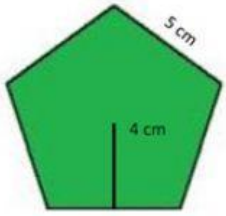

P = ____ cm
A = ____ cm²

LIVEWORKSHEETS