Name: _____ Date: _____

Classify Triangles

Watch this video and then answer the questions below

Match the triangles below to the right box that describes it.

1. 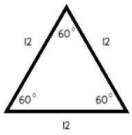

2. 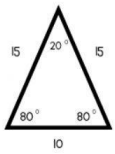

3. 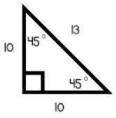

4. 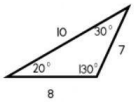

Isosceles and Acute

Scalene and Obtuse

Isosceles and Right

Scalene and Right

Equilateral and Acute

Drag the triangles below to the right box that describes it.

Sides/ Angles	Equilateral	Isosceles	Scalene
Acute			
Right Angled			
Obtuse			

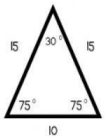

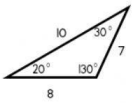

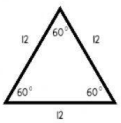

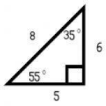

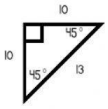

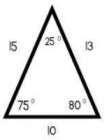

LIVEWORKSHEETS