Thales teorema:

1. Kalkulatu zuhaitzaren altuera:

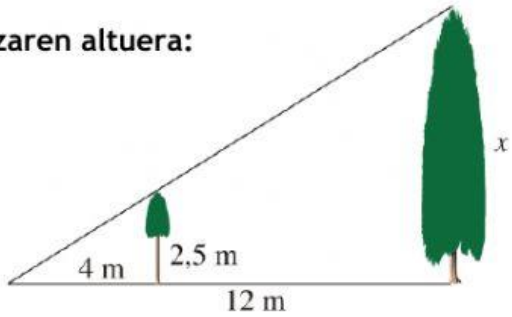

$$\frac{x}{2{,}5} = \frac{\quad}{\quad}$$

$$x = \frac{\quad}{4} = \quad cm$$

2. Kalkulatu alde ezezagunaren altuera:

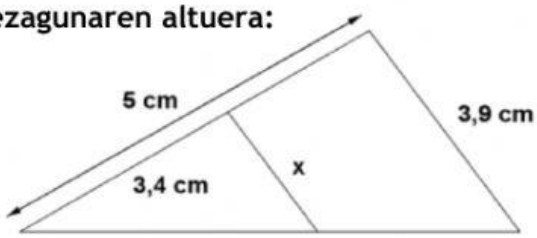

$$\frac{x}{\quad} = \frac{\quad}{\quad}$$

$$x = \frac{\quad}{\quad} = \quad cm$$

3. Kalkulatu alde ezezagunen neurriak:

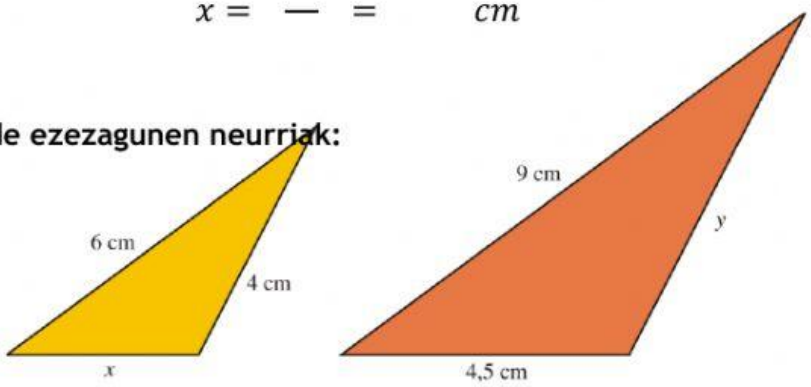

$$\frac{4{,}5}{x} = \frac{\quad}{6} \qquad\qquad \frac{9}{\quad} = \frac{y}{\quad}$$

$$x = \frac{\quad}{9} = \quad cm \qquad\qquad y = \frac{\quad}{\quad} = \quad cm$$

LIVEWORKSHEETS

4. **Kalkulatu alde ezezagunen neurriak:**

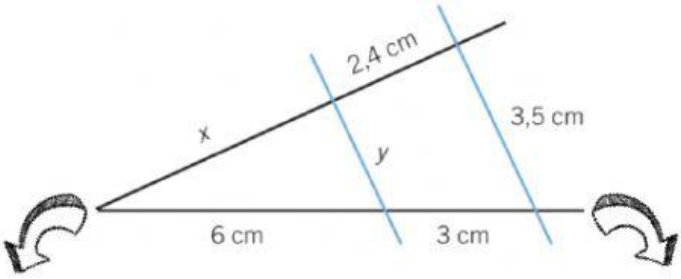

$\frac{x}{6} = \frac{\quad}{\quad}$ $\qquad$ $\frac{y}{6} = \frac{\quad}{\quad}$

$x = \frac{\quad}{3} = \quad cm$ $\qquad$ $y = \frac{\quad}{\quad} = \quad cm$

5. **Kalkulatu alde ezezagunen neurriak:**

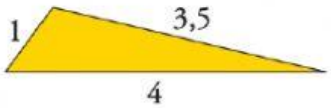

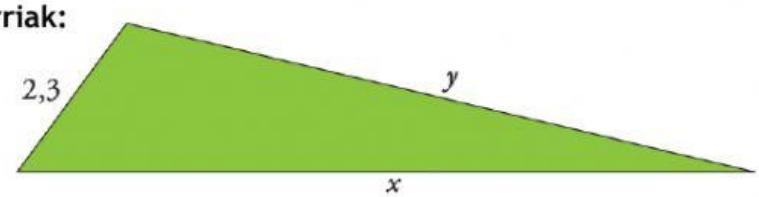

$\frac{4}{x} = \frac{\quad}{\quad}$ $\qquad$ $\frac{y}{\quad} = \frac{2,3}{\quad}$

$x = \frac{\quad}{\quad} = \quad cm$ $\qquad$ $y = \frac{\quad}{\quad} = \quad cm$

6. **Kalkulatu alde ezezagunen neurriak:**

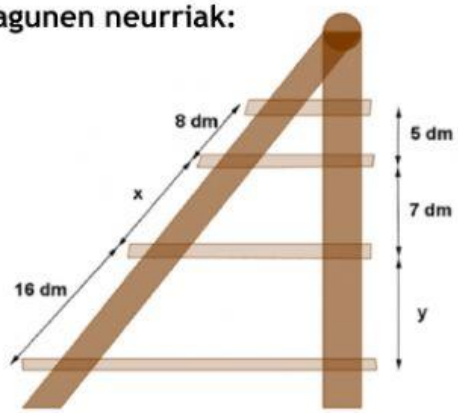

$\frac{x}{\quad} = \frac{8}{\quad}$ $\qquad$ $\frac{y}{\quad} = \frac{5}{\quad}$

$x = \frac{\quad}{\quad} = \quad cm$ $\qquad$ $y = \frac{\quad}{\quad} = \quad cm$

LIVEWORKSHEETS