Cambridge Assessment International Education
Cambridge International School

Cambridge Primary Programme

CAMBRIDGE PRIMARY MATHEMATICS 1

REVISION 2

Name: _____ **Date:**_____ **Class:** _____

Part 1. Tick (✓) the objects that are heavy.

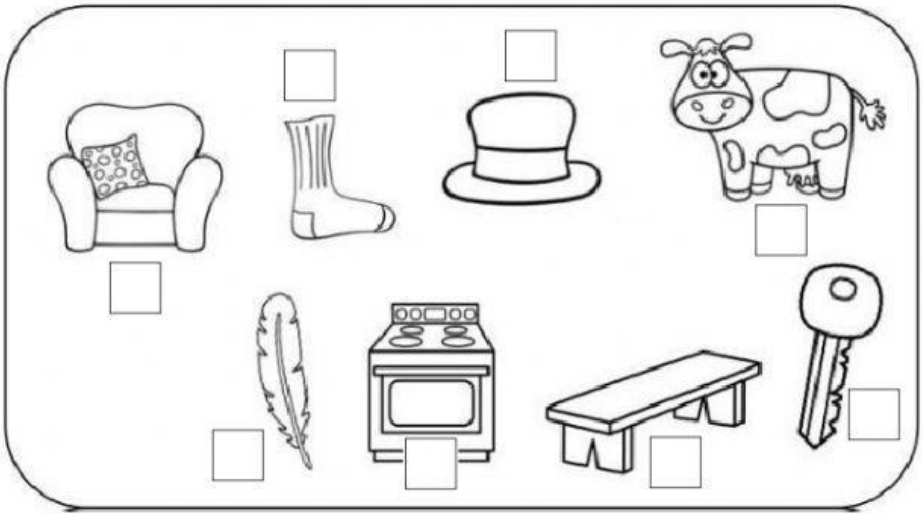

Part 2. Tick (✓) the objects that are light.

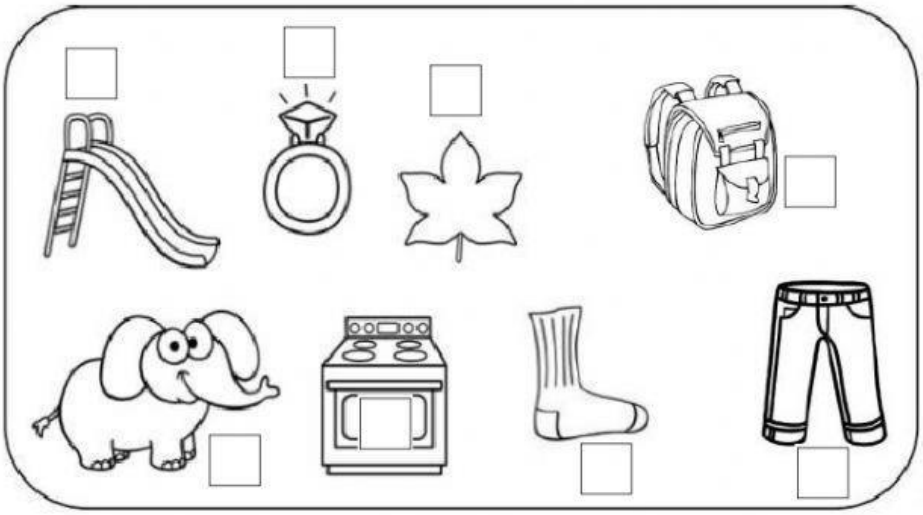

LIVEWORKSHEETS

Part 3. Read and choose.

Choose the lighter object.

Choose the heavier object.

Choose the lighter object.

Choose the heavier object.

LIVEWORKSHEETS

Part 4. Draw lines to match the ordinal number with the ordinal number word.

5th	fourth
2nd	eighth
6th	second
1st	tenth
10th	first
7th	third
3rd	ninth
8th	fifth
4th	seventh
9th	sixth

LIVEWORKSHEETS

Part 5. Read and choose.

Ordinal Numbers

1st First	2nd Second	3rd Third	4th Fourth	5th Fifth	6th Sixth	7th Seventh	8th Eighth	9th Ninth	10th Tenth



Choose the 3rd flower



Choose the 7th flower



Choose the 9th flower



Choose the 2nd flower



Choose the 8th flower

LIVEWORKSHEETS

Part 6. Read and tick (✓) the correct box.

1. Whose has odd number?

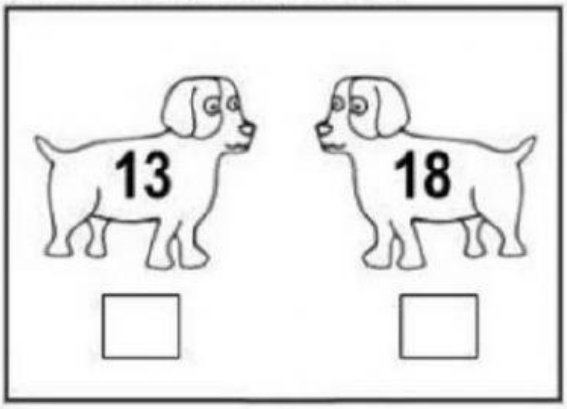

2. Whose has even number?

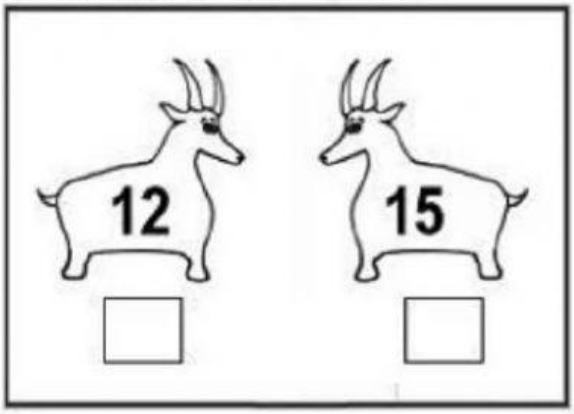

3. Whose has odd number?



4. Whose has even number?

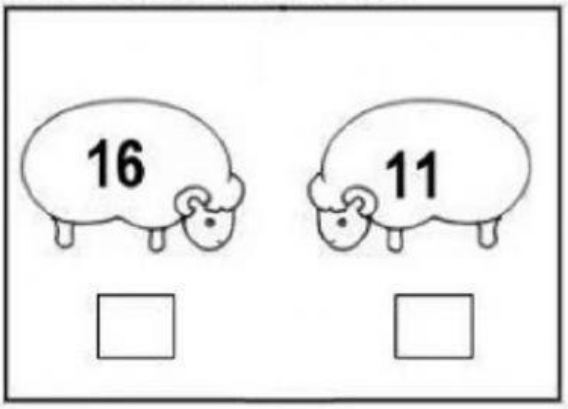

5. Whose has odd number?



6. Whose has even number?

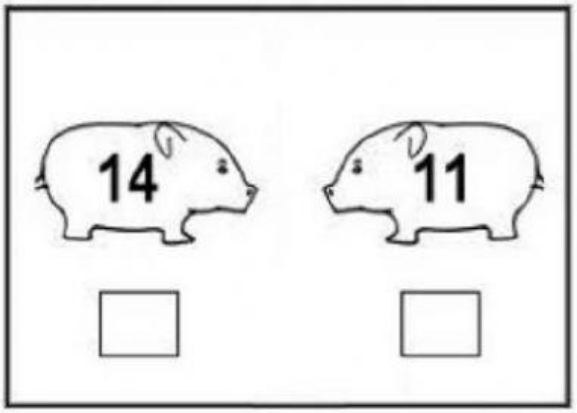

LIVEWORKSHEETS

Part 7. How many pairs of shoes? Draw lines and write the correct answer.

There are ……. pairs.

Part 8. To balance the scales you need the same mass on both sides.

These scales balance.

The CD has the same mass as 2 blocks.

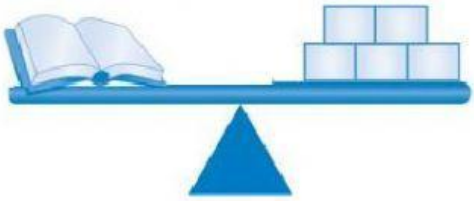

These scales balance.

The book has the same mass as 5 blocks.

How many blocks will balance the CD and the book?

LIVEWORKSHEETS