TUGAS 1

HUBUNGAN ANTAR SUDUT

Nomor 1 dan 2 : sudut penyiku

1. Perhatikan gambar berikut!

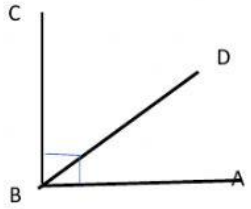

Jika besar $\angle ABD = 30°$, tentukan:

a. $Besar \angle CBD =$ °
b. $Penyiku \angle CBD =$ °

2. Perhatikan gambar berikut!

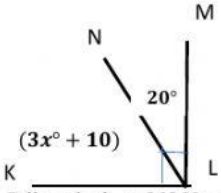

Diketahui $\angle MLN = 20°, \angle KLN = 3x + 10°$, tentukan :

a. $Besar\ x =$ °
b. $Penyiku\ \angle MLN =$ °

Nomor 3 : sudut pelurus

3. Perhatikan gambar berikut!

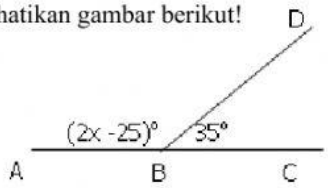

Tentukan nilai x= …….°

Nomor 4 : sudut bertolak belakang

4. Perhatikan gambar berikut!

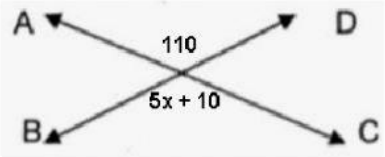

Tentukan nilai x= …….°

Selamat mengerjakan

LIVEWORKSHEETS