# Vertical Subtraction

How many spoons are left?

$$\begin{array}{r} 6 \\ -\ 4 \\ \hline \end{array}$$

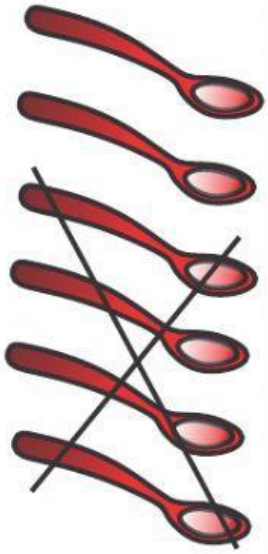

$$\begin{array}{r} 10 \\ -\ 2 \\ \hline \end{array}$$



$$\begin{array}{r} 7 \\ -\ 3 \\ \hline \end{array}$$

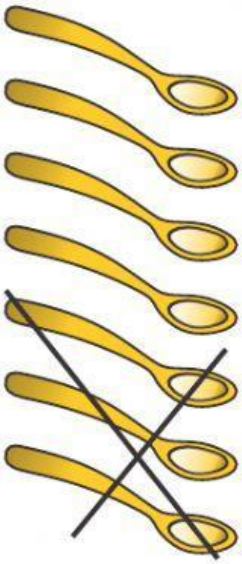

$$\begin{array}{r} 4 \\ -\ 2 \\ \hline \end{array}$$





LIVEWORKSHEETS