الاسم :　　الصف :　　الشعبة :

حجم الأجسام المركبة

أوجد حجم المجسم التالي اعتبر $\pi = 3.14$

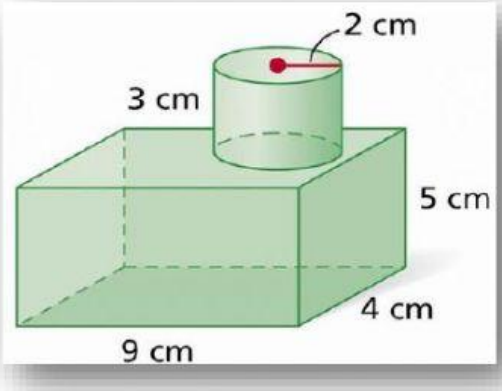

$V =$ $+$

$V =$ cm^3

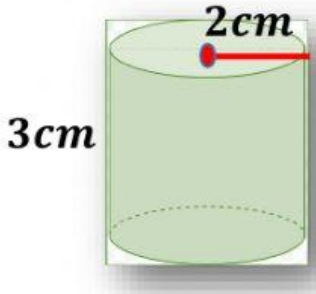

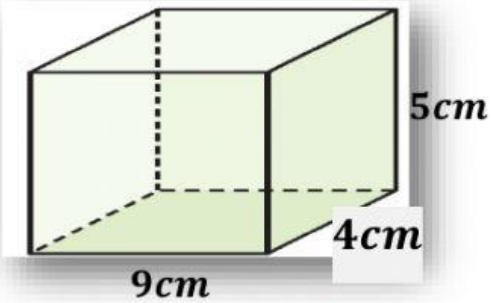

$V_1 = \pi . r^2 . h$

$V_1 =$ $\times$ $\times$

$V_1 =$ cm^3

$V_2 = \ell . W . h$

$V_2 =$ $\times$ $\times$

$V_2 =$ cm^3

LIVEWORKSHEETS