Nama :

Kelas :

GARIS DAN SUDUT

Latihan 5

1. 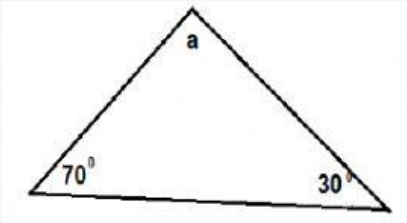

Besar sudut a adalah ... ^{0}

2. 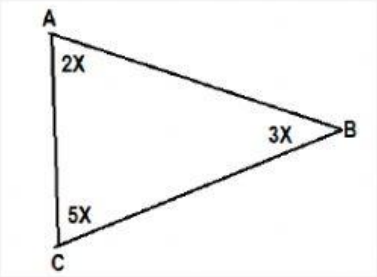

Nilai x adalah ... ^{0}

Besar ∠CBA= .... ^{0}

3. 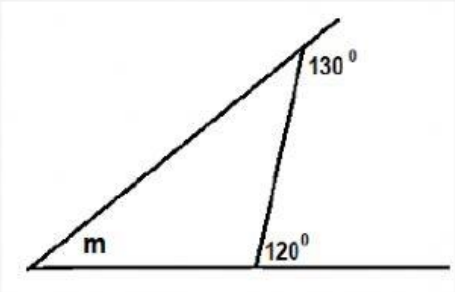

Nilai m adalah ... ^{0}

LIVEWORKSHEETS

4.

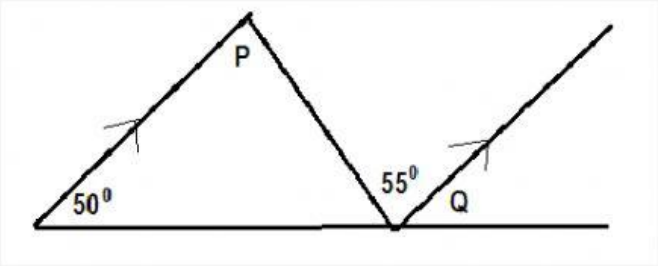

Nilai P = ... °

Nilai Q = ... °

5.

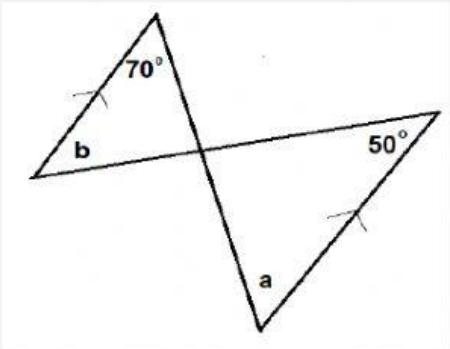

Nilai a = ... ⁰

Nilai b = ... ⁰

6.

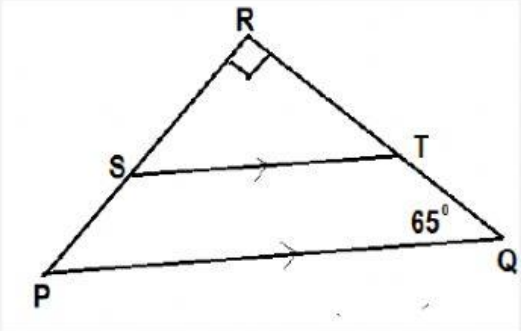

Besar ∠STQ = ... °

Besar ∠RST = ... °

7.

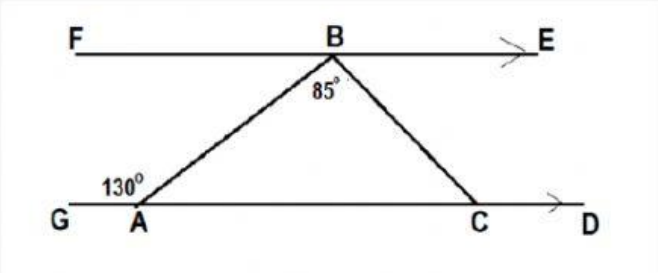

Besar ∠ACB = ... °

Besar ∠CBE = ... °

Besar ∠BCD = ... °

LIVEWORKSHEETS

8.

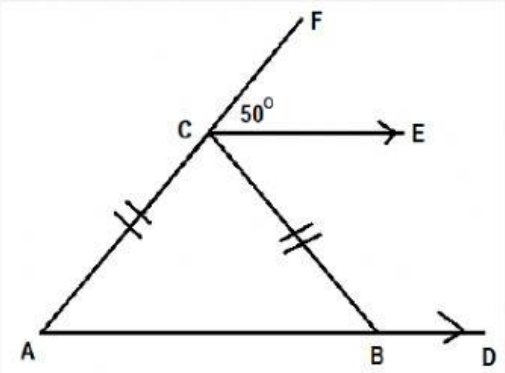

Besar ∠ABC = ... °

Besar ∠ACB = ... °

Besar ∠BCE =... °

9.

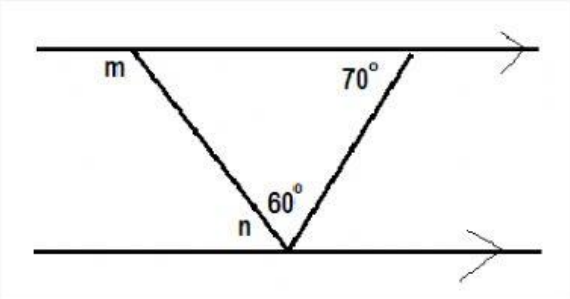

m = ... °

n = ... °

10.

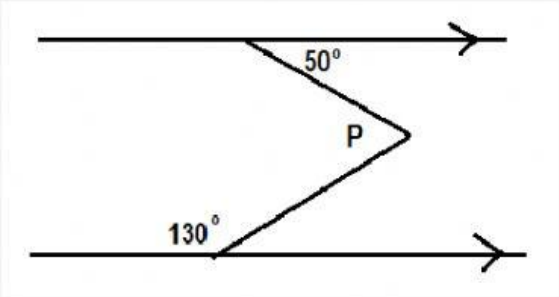

P = ... °

LIVEWORKSHEETS