1. Hány forint van a pénztárcákban? Kösd a pénztárcákhoz a hozzájuk tartozó műveleteket!

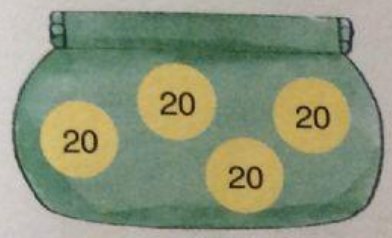

$5 \cdot 200 =$ ☐☐☐☐

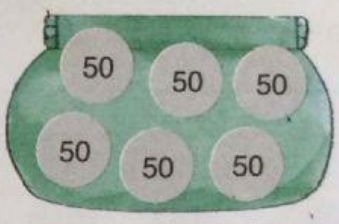

$4 \cdot 20 =$ ☐☐

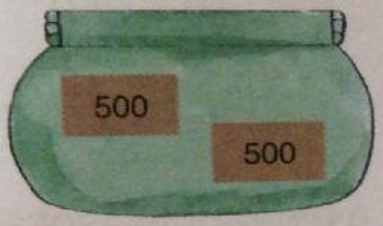

$6 \cdot 50 =$ ☐☐☐



$2 \cdot 500 =$ ☐☐☐☐

8 ☐

LIVEWORKSHEETS