Republic of the Philippines
Department of Education
NATIONAL CAPITAL REGION
SCHOOLS DIVISION OFFICE OF LAS PIÑAS CITY

NAME: _____ **Score:** _____
GRADE & SECTION _____ **Teacher:** _____

WORKSHEET in MATHEMATICS 4
Third Quarter
Week 7 – Day 3

Objective: Measures the perimeter of any given figure using appropriate tools.

A. Direction: Find the perimeter of each figure.

1)

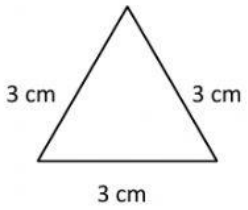

_____

2)

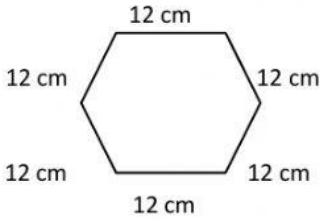

_____

3)

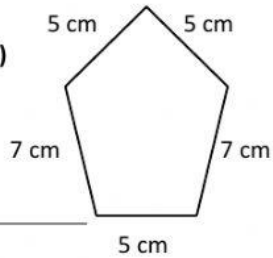

_____

4)

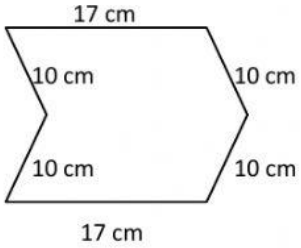

_____

5)

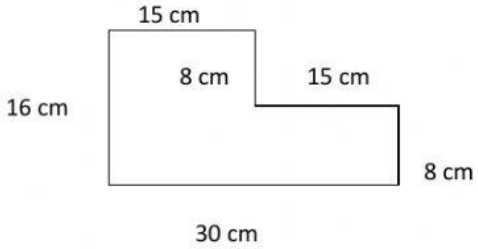

_____

B. Direction: Find the perimeter of each figure.

1)

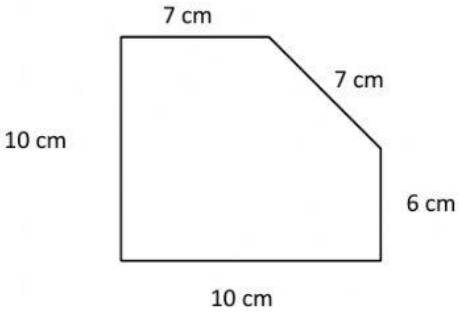

2)

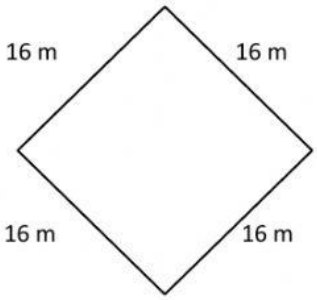

3)

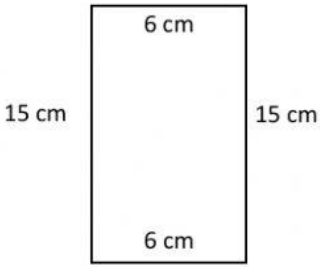

4)

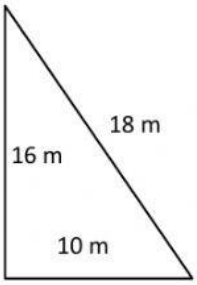

5)

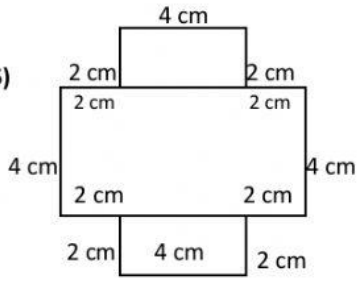

LIVEWORKSHEETS