ICM INSAN CENDEKIA MADANI	Math Review Unit 14 Fractions
☐ Pre-assessment ☐ Independent/ fluency ☐ Individual guided ☐ Assessment	Marks: 15

1. Part of Whole.

Complete.

(a)

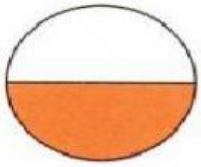

$\frac{1}{\square}$ of the shape is shaded.

The numerator is 1.

The denominator is _____.

(b)

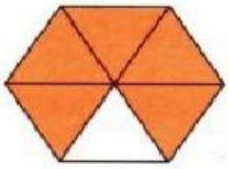

$\frac{\square}{6}$ of the shape is shaded.

The numerator is _____.

The denominator is 6.

[2]

2. Ordering Fractions.

Order $\frac{5}{10}$, $\frac{3}{10}$ and $\frac{9}{10}$ from smallest to largest.

_____, _____, _____

smallest

[2]

LIVEWORKSHEETS

3. Equivalent Fractions.

Match the equivalent fractions by writing the numbers of each fraction!

1.	2.	3.	4.	5.
$\frac{6}{10}$ 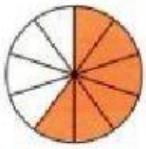	$\frac{4}{6}$ 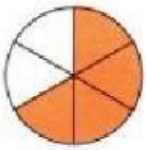	$\frac{3}{6}$ 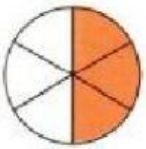	$\frac{2}{8}$	$\frac{5}{5}$

A.	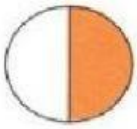 $\frac{1}{2}$ •	
B.	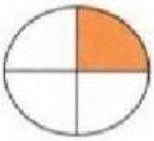 $\frac{1}{4}$ •	
C.	$\frac{3}{3}$ •	
D.	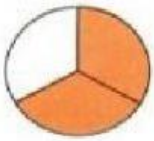 $\frac{2}{3}$ •	
E.	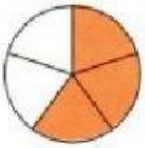 $\frac{3}{5}$ •	

[5]

LIVEWORKSHEETS

4. Comparing Fraction.

Use =, > or < to make the statements correct.

$\frac{5}{8}$ ◯ $\frac{5}{6}$

$\frac{2}{3}$ ◯ $\frac{4}{6}$

[2]

5. Fraction and Decimals.

$\frac{5}{10}$ = _____ $\frac{7}{10}$ = _____

$\frac{5}{100}$ = _____ $\frac{9}{100}$ = _____

[4]

LIVEWORKSHEETS