Mengenal Keliling
Tematik Tema 6

SD Darul Hikam
Berakhlak Berprestasi

Nama : Kelas :

بسم الله الرحمن الرحيم

Pilihlahlah jawaban yang paling benar!

1. Berapakah keliling bangun dibawah ini . . . .

a. 16
b. 18
c. 20
d. 22

LIVEWORKSHEETS

2. Berapakah keliling bangun di bawah ini

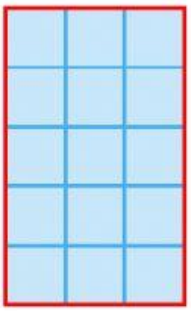

a. 5
b. 12
c. 16
d. 20

3. Berapakah keliling bangun di bawah ini

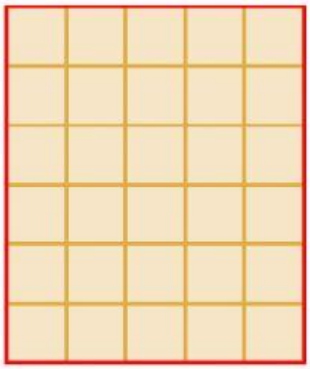

a. 20
b. 22
c. 24
d. 26

LIVEWORKSHEETS

4. Berapakah keliling bangun di bawah ini . . . .

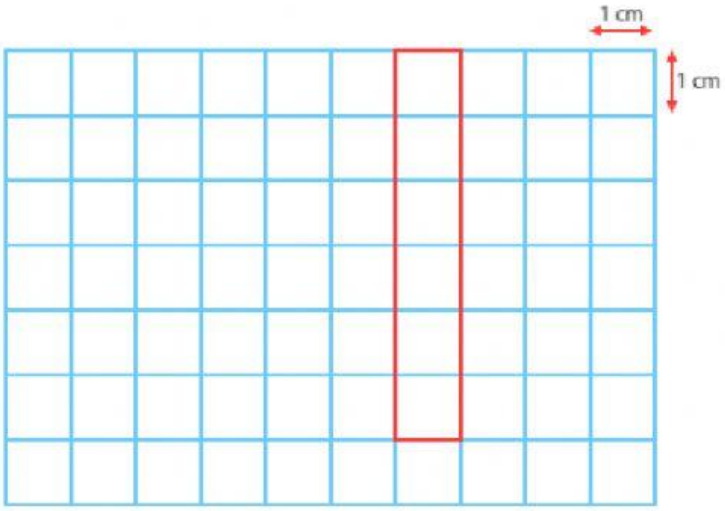

a. 12 cm
b. 14 cm
c. 16 cm
d. 18 cm

5. Berapakah keliling bangun di bawah ini . . . .

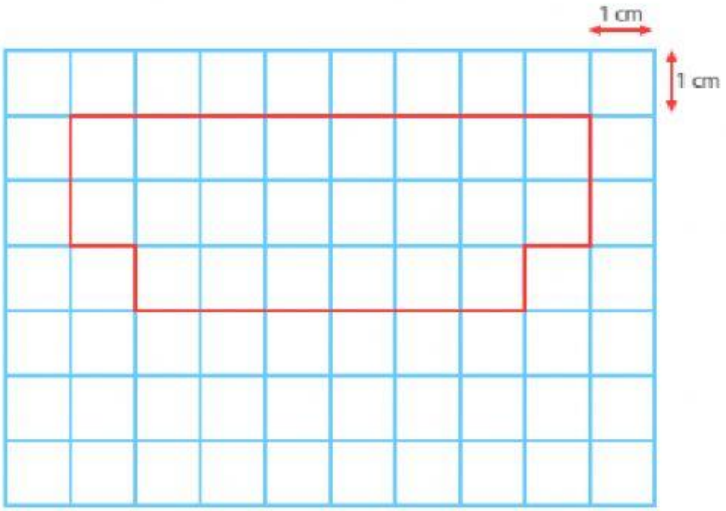

a. 18 cm
b. 20 cm
c. 22 cm
d. 24 cm

LIVEWORKSHEETS

6. Berapakah keliling bangun di bawah ini . . . .

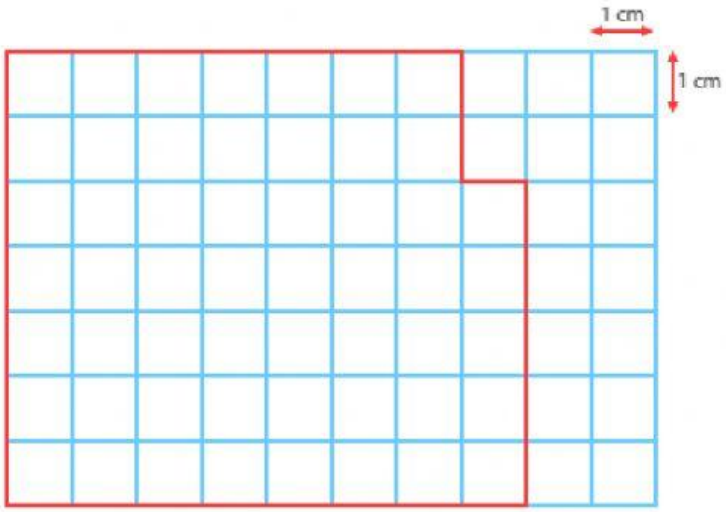

a. 26 cm
b. 28 cm
c. 30 cm
d. 32 cm

7. Berapakah keliling bangun di bawah ini . . . .

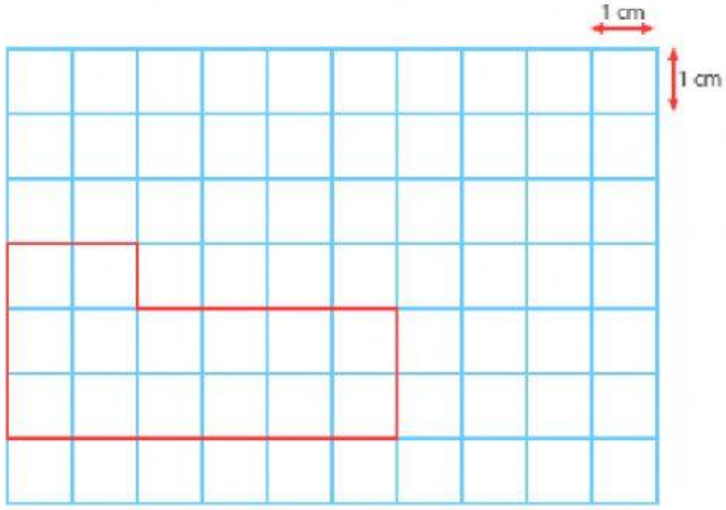

a. 18 cm
b. 19 cm
c. 20 cm
d. 21 cm

LIVEWORKSHEETS

8. Berapakah keliling bangun di bawah ini . . . .

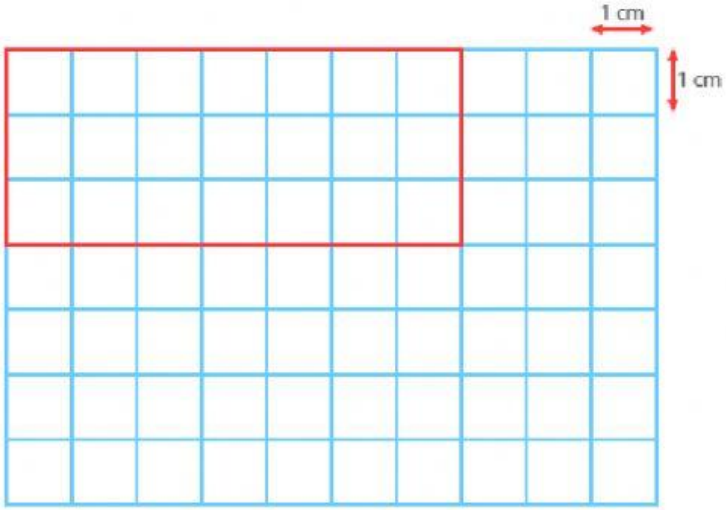

a. 15 cm
b. 20 cm
c. 25 cm
d. 30 cm

9. Berapakah keliling bangun di bawah ini . . . .

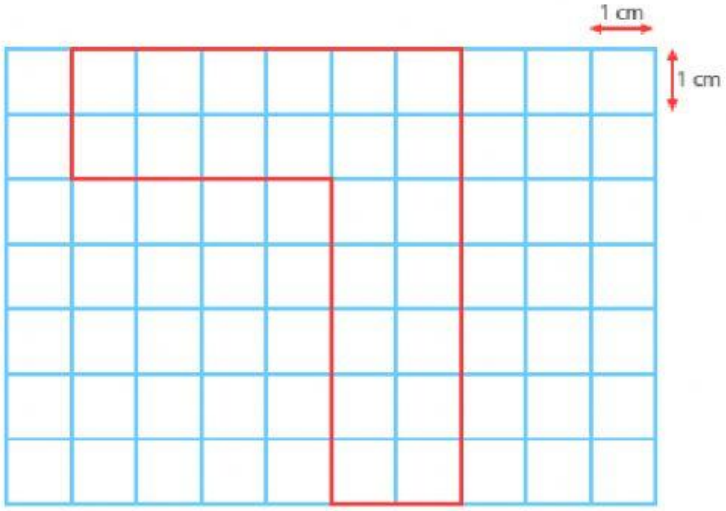

a. 26 cm
b. 27 cm
c. 28 cm
d. 29 cm

LIVEWORKSHEETS

10.Berapakah keliling bangun di bawah ini . . . .

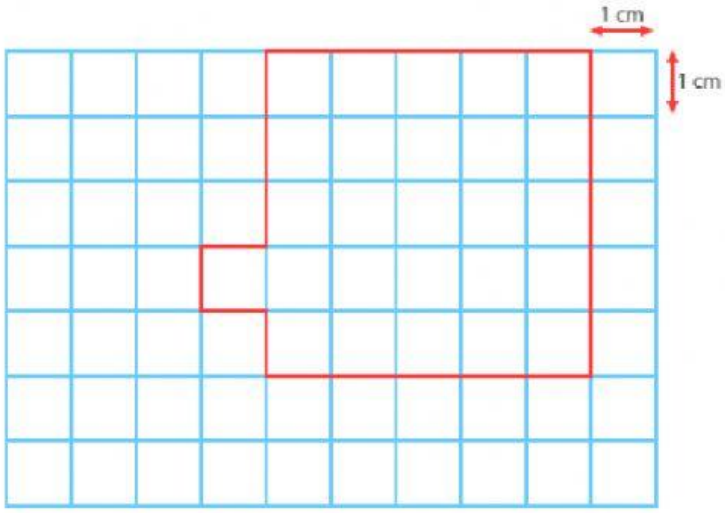

a. 16 cm
b. 18 cm
c. 20 cm
d. 22 cm

ٱلْحَمْدُ لِلَّهِ رَبِّ ٱلْعَٰلَمِينَ

LIVEWORKSHEETS