Name/Class: _____

Telling Time Word Problem

Solve the problems. Fill in the correct answer in the timeline.

1. Gina exercises every morning.
   She starts at 6:00 a.m. and ends at 9:00 a.m.
   How long does she exercise?

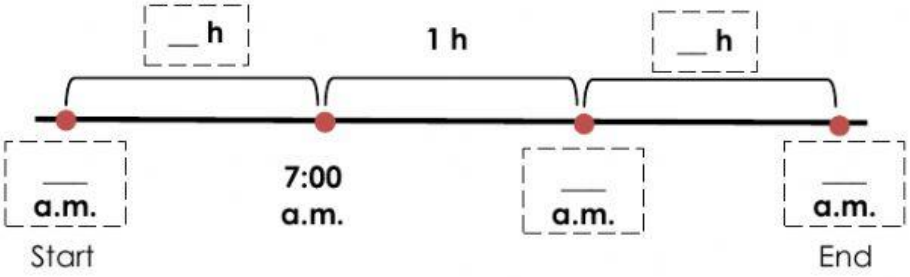

Duration = _____ h + _____ h + _____ h

= _____ h

She exercises for ____ h

2. Dimas visited his friend's house at 11:40 a.m.
   He stayed there for 3 h 15 min
   What time did he leave his friend's house?

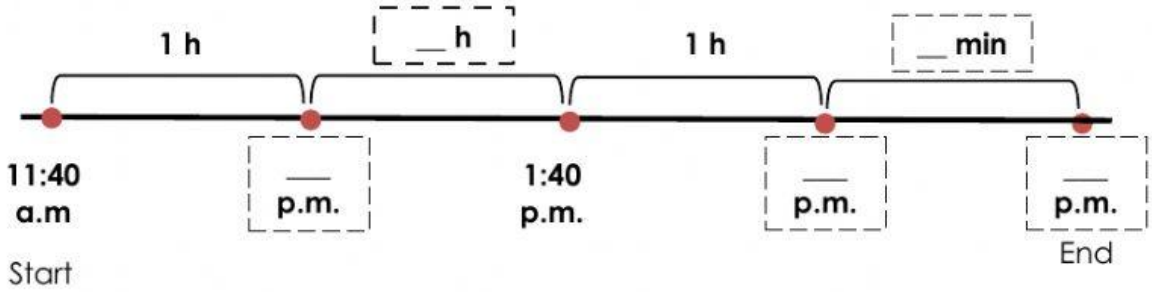

Dimas left his friend's house at ___ p.m.

diana_n@sekolahbogorraya.com
LIVEWORKSHEETS

3. It takes Charlie 1 hours 45 minutes to reach his home town from the city.
He starts his journey at 9:30 p.m.
What time will he reach his home town?

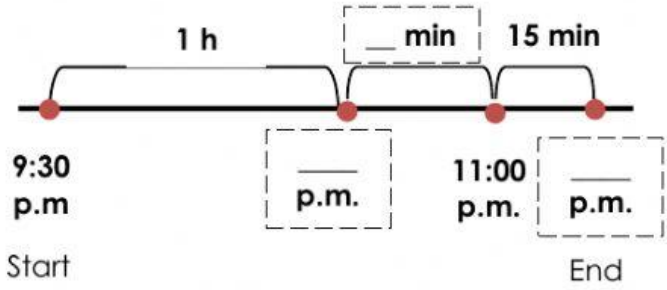

Charlie will reach his home town at _____ p.m.

4. Our lunch time started at 12:00 p.m.
We finished at 1:10 p.m.
How long was our lunch?

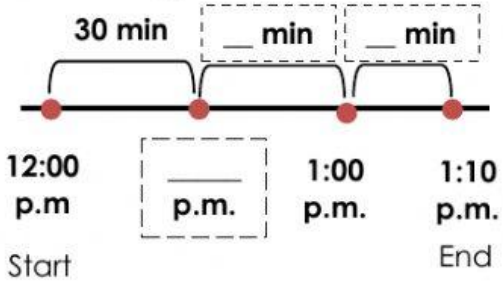

Duration = _____ min + _____ min + _____ min

= _____ min

= _____ h _____ min

Our lunch was ____ h _____ min

diana_n@sekolahbogorraya.com
LIVEWORKSHEETS