Demostramos lo aprendido

1. Hallar la gráfica de: $2x - y - 3 > 0$

Sugerencia: Aplique GeoGebra

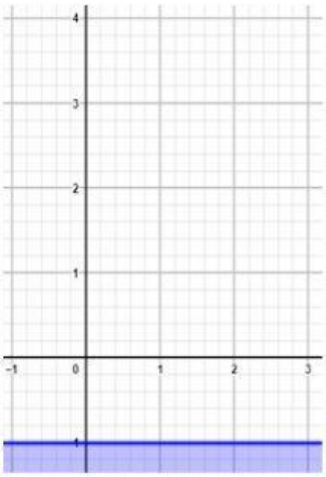

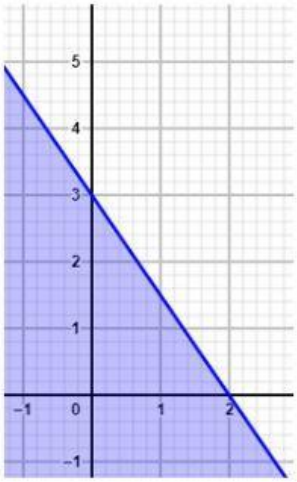

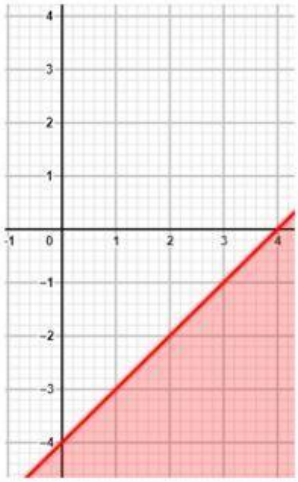

Lic. Angel Maidana Cuadros

LIVEWORKSHEETS