Nama : _____ **Kelas :** _____

A. Berdasarkan graf fungsi kuadratik di bawah, tandakan **X** dan nyatakan punca bagi persamaan kuadratik yang diberikan. **SP1.1.5 TP2**

Contoh: $f(x) = x^2 - 2x - 3$

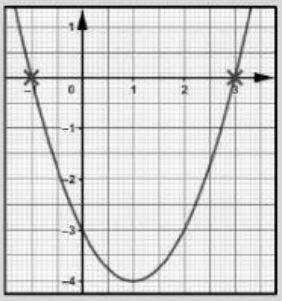

Punca:
$x = -1, x = 3$

1. $f(x) = x^2 + 5x + 6$

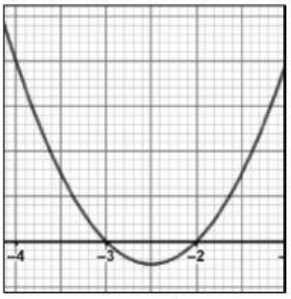

Punca,x = _____ _____

2. $f(x) = x^2 + x - 2$

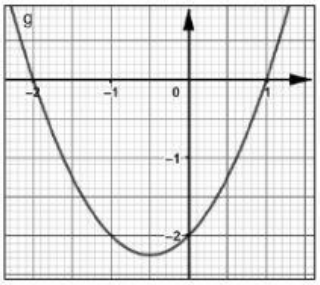

Punca,x = _____ _____

3. $f(x) = x^2 - 3x$

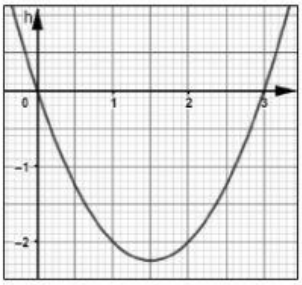

Punca,x = _____ _____

4. $f(x) = -(x-1)^2$

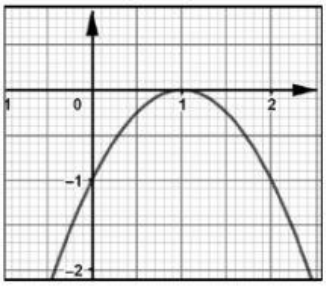

Punca,x = _____

5. $f(x) = -2x^2 + 2x + 4$

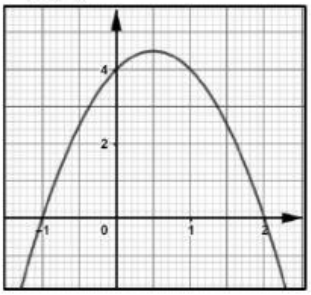

Punca,x = _____ _____

LIVEWORKSHEETS