ONEWORLD

MONTESSORI HOUSE

3rd Quarterly Assessment

Mathematics 1

March 29-31, 2022

Name: _____ Date: _____

Multiplication

I. Solve each problem with repeated addition, grouping and multiplication.



Add: _____ + _____ = _____

_____ groups of _____

Multiply: _____ x _____ = _____

Add: _____ + _____ + _____ + _____ = _____

_____ groups of _____

Multiply: _____ x _____ = _____

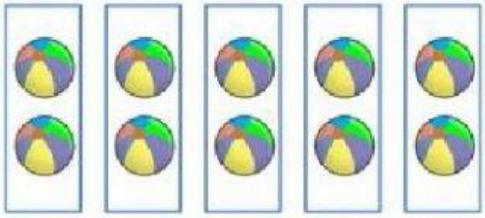

Add: ____ + ____ + ____ + ____ + ____ = _____

_____ groups of _____

Multiply: _____ x _____ = _____



Add: _____ + _____ + _____ + _____ = _____

_____ groups of _____

Multiply: _____ x _____ = _____

Add: _____ + _____ + _____ = _____

_____ groups of _____

Multiply: _____ x _____ = _____

LIVEWORKSHEETS

Fractions

I. Name the following fractions by putting the missing number.

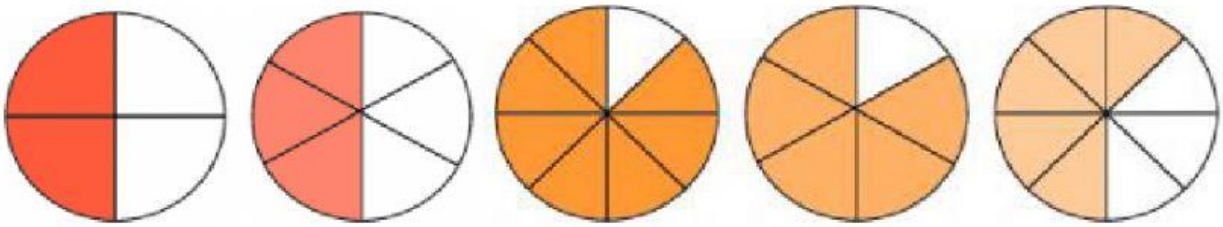

$\frac{\square}{4}$	$\frac{3}{\square}$	$\frac{7}{\square}$	$\frac{\square}{6}$	$\frac{\square}{\square}$

II. Comparing the fractions by putting <, >, or =.

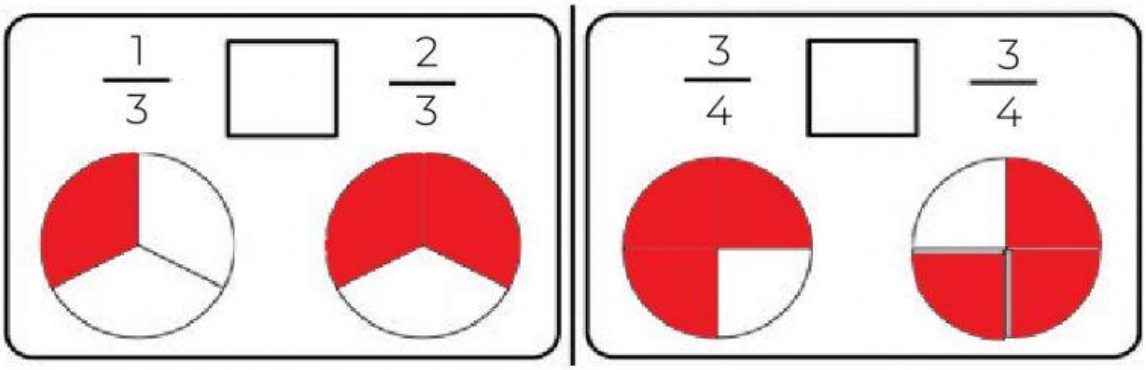

$\frac{1}{8}$ ◯ $\frac{5}{8}$ $\frac{7}{10}$ ◯ $\frac{4}{10}$ $\frac{4}{6}$ ◯ $\frac{2}{6}$

III. Order the following fractions

(a) Arrange from ***least to greatest***.

1. $\frac{5}{8}, \frac{3}{8}, \frac{1}{8}, \frac{7}{8}$

$\frac{\square}{\square}$	$\frac{\square}{\square}$	$\frac{\square}{\square}$	$\frac{\square}{\square}$

(b) Arrange from ***greatest to least***.

2. $\frac{4}{6}, \frac{6}{6}, \frac{3}{6}, \frac{2}{6}$

$\frac{\square}{\square}$	$\frac{\square}{\square}$	$\frac{\square}{\square}$	$\frac{\square}{\square}$

LIVEWORKSHEETS

IV. Comparing Dissimilar Fractions. Tick the greater or lesser fraction.

(a) Which fraction is greater?

☐ $\frac{5}{7}$ 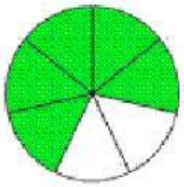

☐ $\frac{1}{3}$ 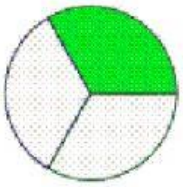

(b) Which fraction is less?

☐ $\frac{4}{6}$ 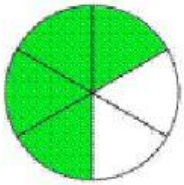

☐ $\frac{2}{8}$ 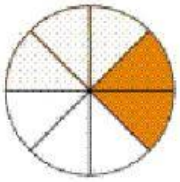

Word Problems

V. Addition, Subtraction and Multiplication Word Problems

1. Each plate has 2 pastries. How many pastries are there altogether?

_____ ☐ _____ = _____

2. There are 5 lions in the jungle. There are 4 lions in the grassland. How many lions are there in all?

_____ ☐ _____ = _____

3. Leo had 8 color pencils. He lost 4 of them. How many color pencil are left?

_____ ☐ _____ = _____

LIVEWORKSHEETS