Math Evaluation
3rd Bimester
Period 2021-2022

Name: _____ **Grade:** _____

A. Tell if the given models show an equivalent fraction.

1.

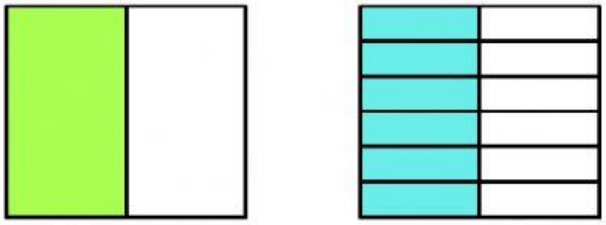

Yes: ☐

No: ☐

2.

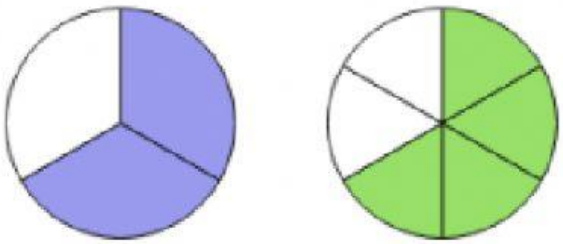

Yes: ☐

No: ☐

LIVEWORKSHEETS

B. Label the two lines below with fractions.

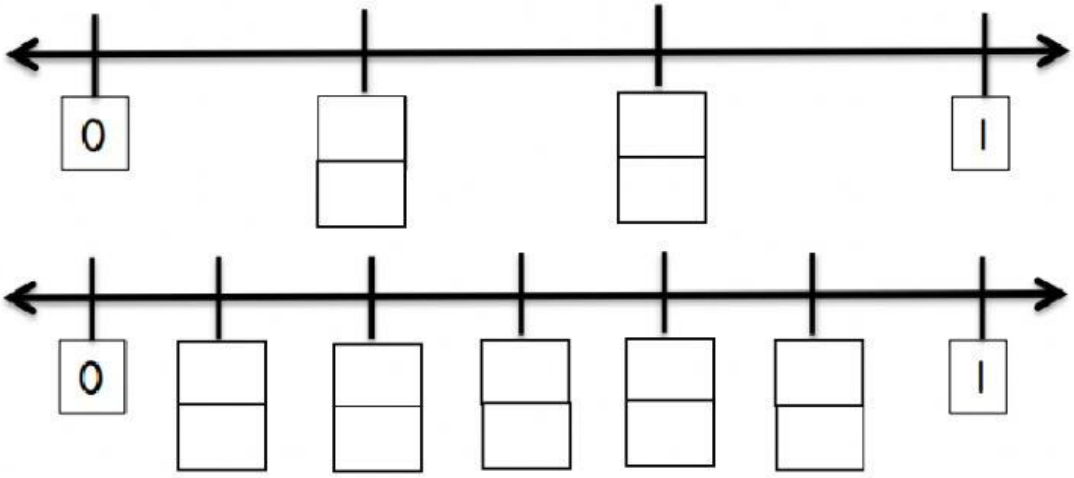

- Identify two sets of equivalent fractions on the number line above.

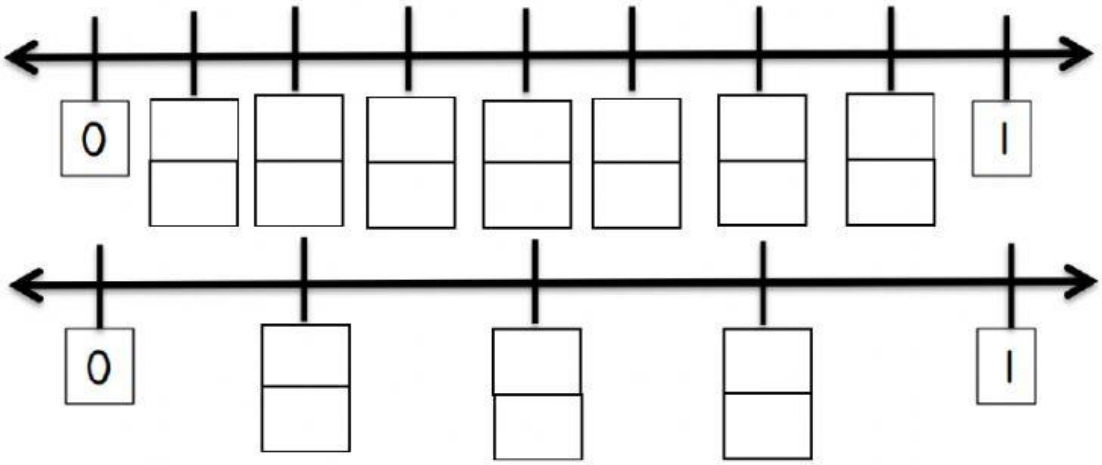

LIVEWORKSHEETS

- Identify three sets of equivalent fractions on the number line above.

$\frac{\square}{\square} : \frac{\square}{\square}$ $\frac{\square}{\square} : \frac{\square}{\square}$

$\frac{\square}{\square} : \frac{\square}{\square}$

C. Compare the fractions below. Circle **>** , **<** or **=**

1. $\frac{3}{9}$ ◯ $\frac{5}{15}$ **>** **<** **=**

2. $\frac{2}{8}$ ◯ $\frac{3}{6}$ **>** **<** **=**

3. $\frac{5}{8}$ ◯ $\frac{3}{8}$ **>** **<** **=**

LIVEWORKSHEETS

D. Use the number line to compare the fraction A and B. Explain on the box below which fraction is greater and which is less and why.

A.

B.

LIVEWORKSHEETS