Fractions

Practice 1 Understanding Fractions

(1) Fill in the blanks.

Example

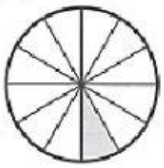

__1__ out of __12__ equal parts is shaded.

$\frac{1}{12}$ of the figure is shaded.

(a)

_____ out of _____ equal parts is shaded.

$\frac{\square}{\square}$ of the figure is shaded.

(b)

_____ out of _____ equal parts is shaded.

$\frac{\square}{\square}$ of the figure is shaded.

(c)



_____ out of _____ equal parts are shaded.

$\frac{\square}{\square}$ of the figure is shaded.

(d)



_____ out of _____ equal parts are shaded.

$\frac{\square}{\square}$ of the figure is shaded.

(e)

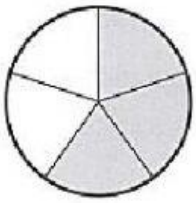

_____ out of _____ equal parts are shaded.

$\frac{\square}{\square}$ of the figure is shaded.

(f)

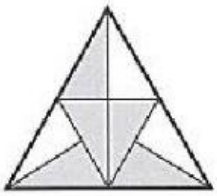

_____ out of _____ equal parts are shaded.

$\frac{\square}{\square}$ of the figure is shaded.

LIVEWORKSHEETS