TML PRIMARY SCHOOL, LIBERTVILLE

JANUARY- MARCH 2022

MATHEMATICS ASSESSMENT

INFANT 1

Name: _____ Total Marks: 36

Section A - Online

Nos	Questions	Marks
1.	**Count** and write the amount for each. 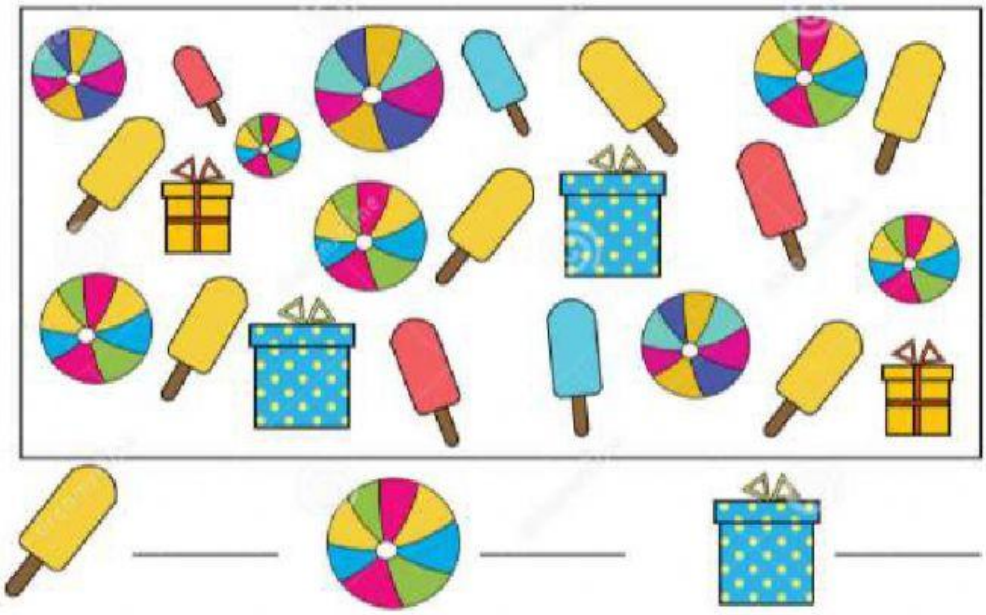 _____ _____ _____	3
2.	**Spell** the following numbers: - _____ - _____	2

LIVEWORKSHEETS

3.	Which group has **more than** 7 objects? 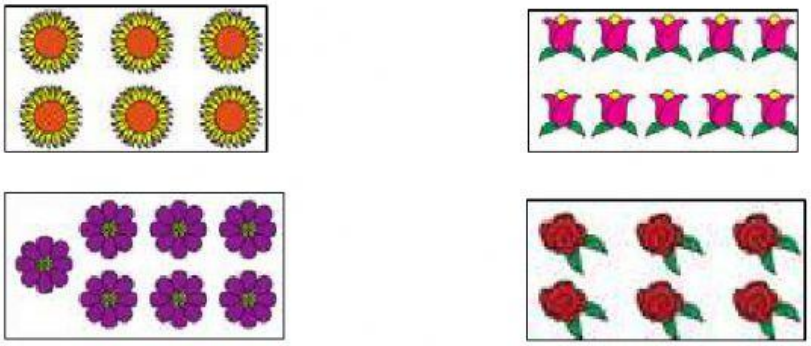	1
4.	 What is the name of the **green** shape? _____ What is the name of the **red** shape? _____	2
5.	Select what is shown on each coin. Humming bird Bird of Paradise Hibiscus Chaconia	2
6.	Select all flat faces to make up a cube. 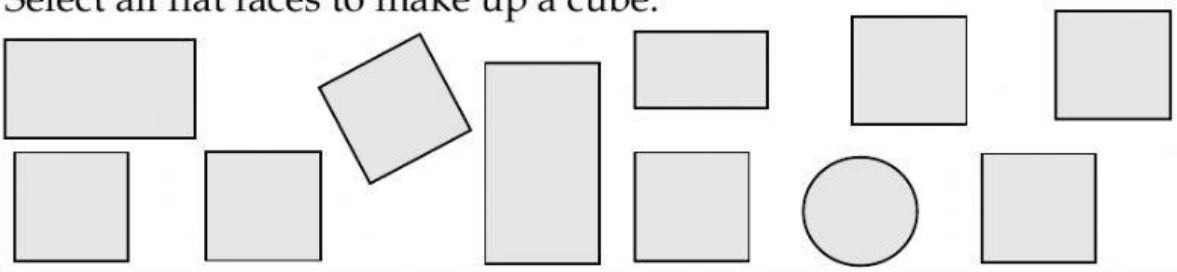	1

LIVEWORKSHEETS

7.	Choose the correct **shape** to complete the patterns. 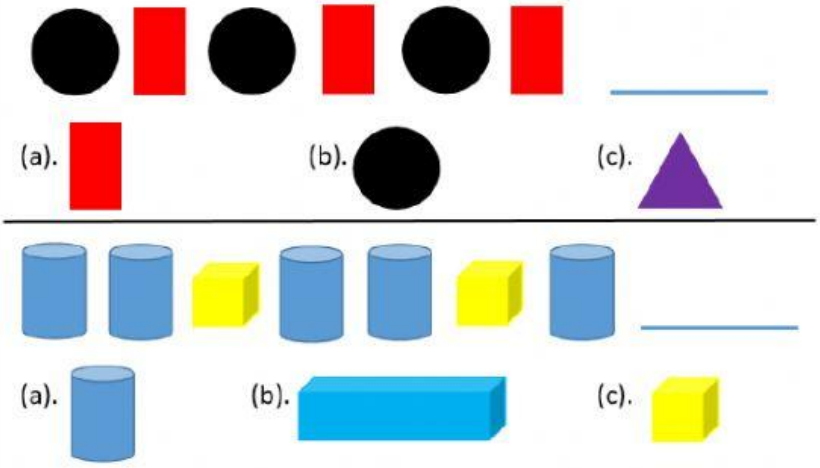 	2
8.	Fill in the missing numbers. 3 ___ 5 ___ 8 9 ___ 2 ___ ___ 5 ___	3
9.	Choose the shape which best matches the real life object. 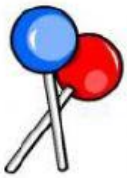 **cone** **cuboid** **cylinder** **circle** **sphere** **cone**	2

LIVEWORKSHEETS

10.	Answer the questions based on the Picture Chart.	4

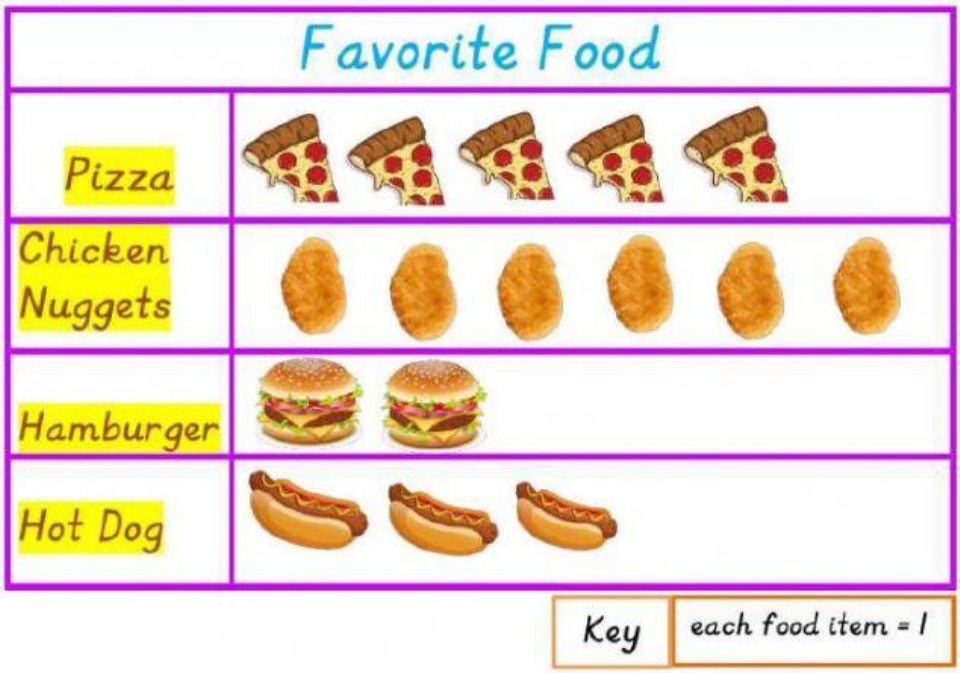

1. How many students like hot dog? _____

2. Which food was liked the **most**? _____

3. Which food was liked the **least**? _____

4. How **many more** students likes pizza than hamburger?

_____

Section B – Written

Show your workings to solve the following

End of Test!

LIVEWORKSHEETS