Name: .....

Class: ..... Date: ..... /...../ 2022

# WORKSHEET - MATHS
# Week 30 – Equal sharing

*Teacher's comments:*.....

**Exercise 1: Write the division sentence and answer the questions.**



____ ÷ ____ = ____

How many bananas does each kid get?

_____ bananas

____ ÷ ____ = ____

How many muffins does each kid get?

_____ muffins



____ ÷ ____ = ____

How many pretzels does each kid get?

_____ pretzels



____ ÷ ____ = ____

How many cherries does each kid get?

_____ cherries

**Exercise 2: Read the words and write the division sentence.**

a. fourteen divided by two equals seven

☐ ÷ ☐ = ☐



LIVEWORKSHEETS

b. Twelve divided by four equals three

☐ ÷ ☐ = ☐

c. Fifteen divided by three is equal to five

☐ ÷ ☐ = ☐

**Exercise 3: Fill in the blanks. (Only write the number)**

| | |
|---|---|
|  | How many groups of 2 are there?<br>_____ |
|  | How many groups of 3 are there?<br>_____ |
|  | How many groups of 4 are there?<br>_____ |
| | How many groups of 5 are there?<br>_____ |
| | How many groups of 4 are there?<br>_____ |
| 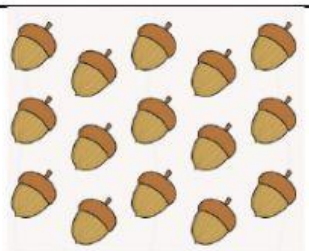 | How many groups of 3 are there?<br>_____ |

LIVEWORKSHEETS