Medidas de Masa



Responde:

¿Por qué el hipopótamo y el conejo no pueden balancearse?

¡Recuerda!:

- 1 kilo equivale a 2 medios kilos.

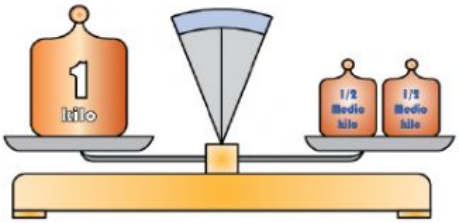

- 1 kilo equivale a 4 cuartos de kilo.

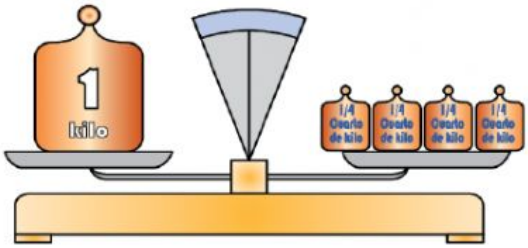

LIVEWORKSHEETS

¡Ahora, hazlo tú!

1. Responde, ¿qué cantidad hay?

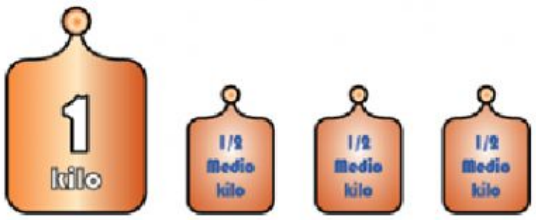

Hay: _____

Hay: _____

Hay: _____

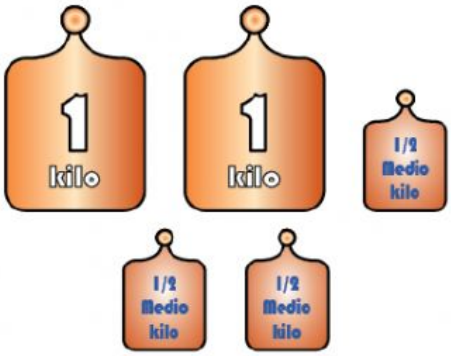

Hay: _____

Hay: _____

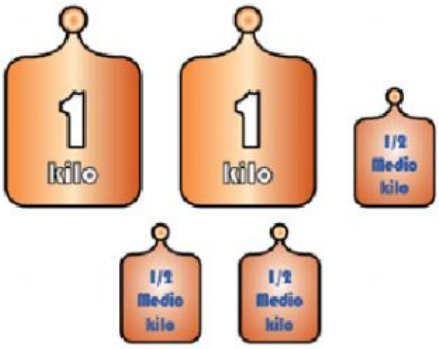

Hay: _____

LIVEWORKSHEETS

Todos los cuerpos tienen peso...

1. Observo la balanza y completo con la palabra más, menos o igual.



La tiene ____ peso que la . La tiene _____ peso que la .

Los tienen ____ peso que el . El tiene ____ peso que la .

2. Observo la balanza y escribo el peso de cada objeto.

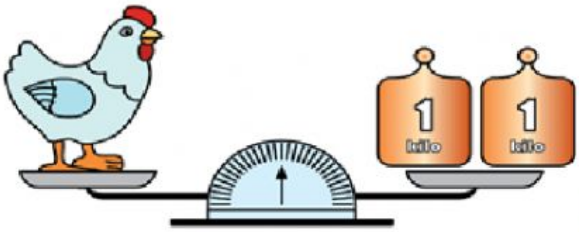

Peso de la gallina = _____ kg

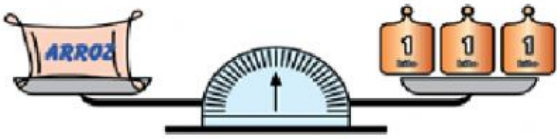

Peso del saco de arroz = _____ kg

LIVEWORKSHEETS

3. Observo la balanza y marco el peso de cada objeto.

peso = _____ kg

peso = _____ kg

peso = _____ kg

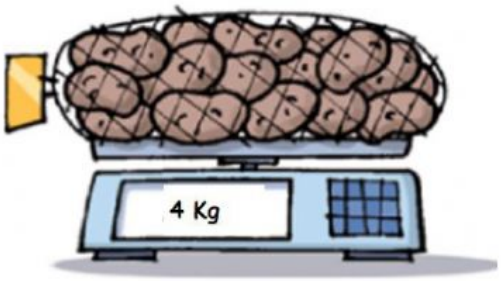

peso = _____ kg



peso = _____ kg

LIVEWORKSHEETS