Mathematics Revision 2

1. Select the **6th** butterfly.

2. What number comes **before** **16**? _____

3. Select the set with **14** objects.



4. Type the missing numbers.

5. Jantje loves animals. He has **6** turtles, **4** parrots and 6 dogs. How many animals he has **in all**?

Answer: _____ animals

LIVEWORKSHEETS

6. Measure the pencil using the paperclips.

The pencil is _____ paperclips long.

7. How much money do I have?

Answer: _____ dollars

8. Select all the 3D shapes needed to build the shape on the left.

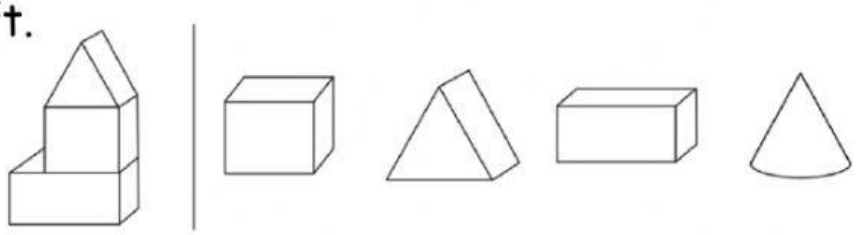

9. Complete the sentence below.

ball

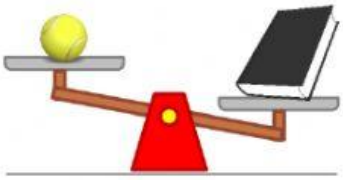

book

The _____ is **lighter than** the _____.

LIVEWORKSHEETS

10. The pictograph shows the votes for favourite fruits in a class. Look at the pictograph and answer the questions below.

Our Favourite Fruits



Key: one picture= 1 vote

a) How many children voted **in all**? _____

b) How many children like **apples**? _____

c) Which fruit **most** children like? _____

d) Which fruit is the **least** favourite? _____

e) How many **more** children like **strawberry** than **apple**?_____

LIVEWORKSHEETS