Hitunglah volume bangun-bangun berikut. Jika perlu gunakan kalkulator.

1.

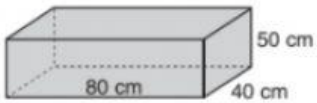

2.

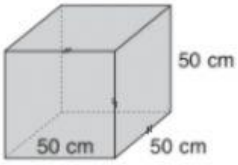

3.

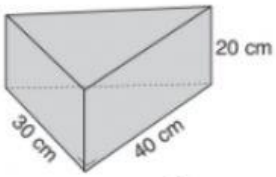

4.

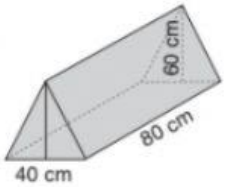

5.

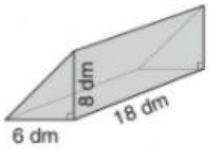

6.

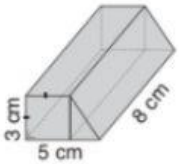

7.

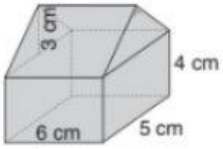

8.

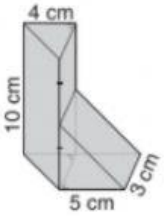

9.

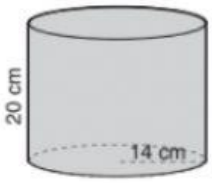

10.

LIVEWORKSHEETS