CONJUNTOS

1. Una con una línea según corresponda.

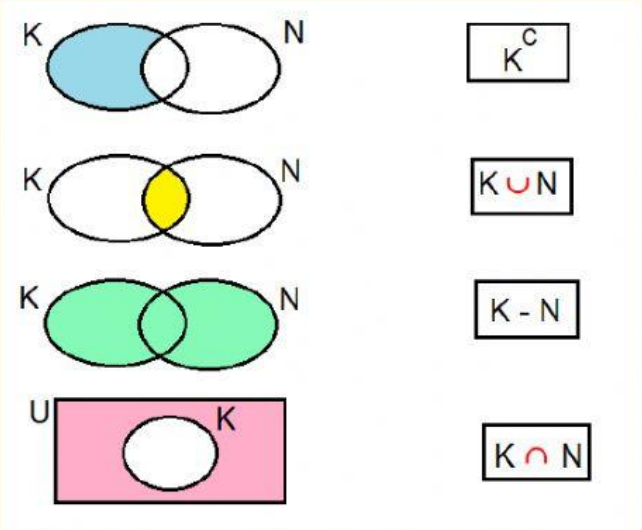

2. Observa los conjuntos y selecciona la respuesta correcta.

A)

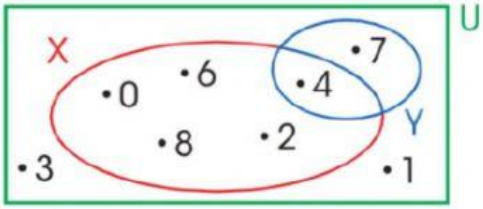

$X \cap Y =$ _____

$X \cup Y =$ _____

B)

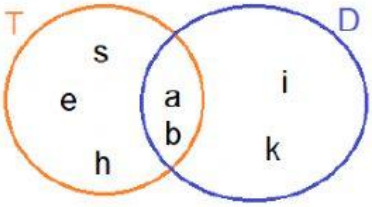

T - D = _____

$T \cap D =$ _____

C) A: {1,2,3,4,5} B: {0,2,4,6}
U: {0,1,2,3,4,5,6}

$A^c =$ _____

$B^c =$ _____

LIVEWORKSHEETS