Utilizando las engrapadoras como unidad de medida, a ¿cuántas engrapadoras equivale cada uno de los objetos presentados?

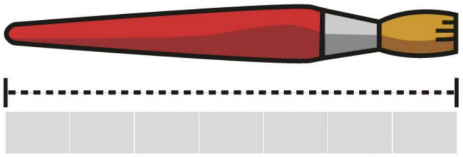

El pincel mide ____ engrapadoras.

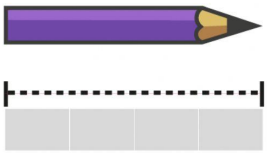

El lapiz mide ____ engrapadoras.



El borrador mide ____ engrapadoras.

LIVEWORKSHEETS