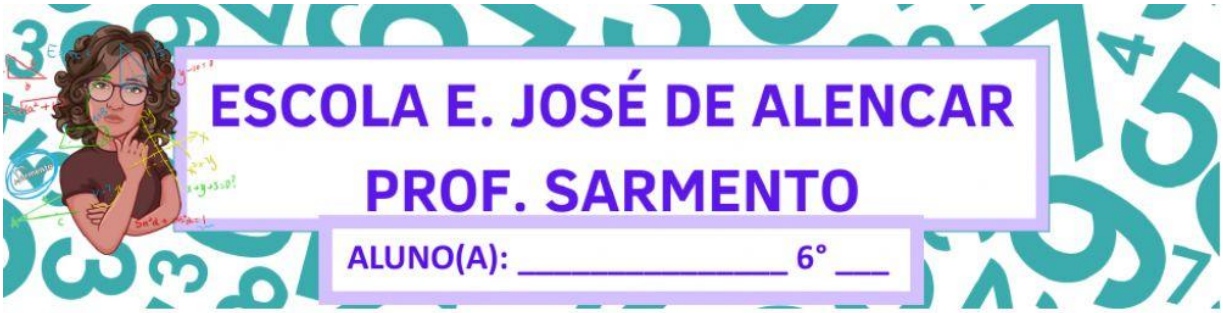

ESCOLA E. JOSÉ DE ALENCAR
PROF. SARMENTO

ALUNO(A): _____ 6° ___

1. Selecione o grupo de símbolos onde todos fazem parte do sistema de numeração egípcio.

a)

b)



c)

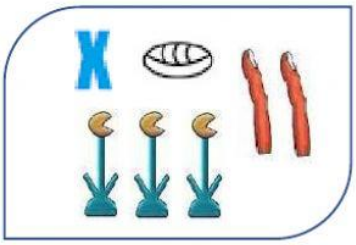

c)

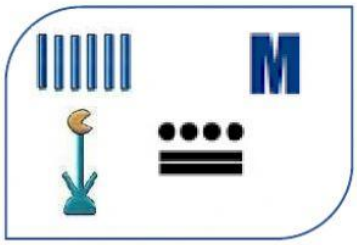

2. Represente, utilizando o nosso sistema de numeração, a alternativa selecionada na questão anterior.

Resp.

3. Marque a representação corretas dos números representados pelo sistema romano.

LXIV	44
	56
	64

CDII	402
	62
	602

LIV	54
	55
	56

LIVEWORKSHEETS