Nickname: _____ Quiz No.: _____

Part 1: Match the shape with the name.

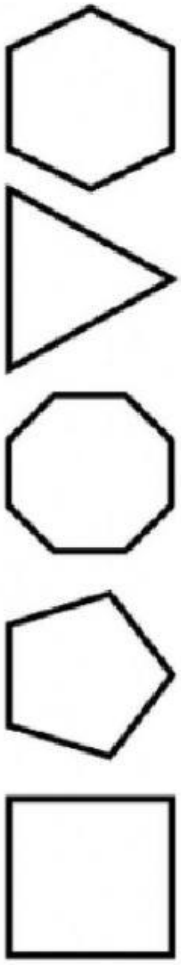

square

pentagon

hexagon

triangle

octagon

Part 2: Circle symmetric or not symmetric.

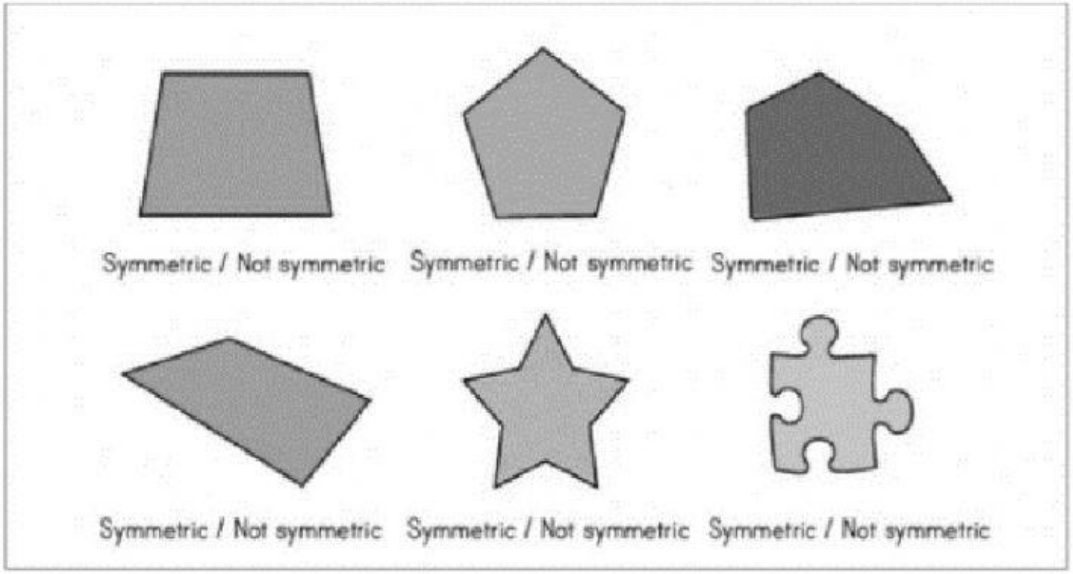

LIVEWORKSHEETS

Part 3: Look at the pictogram/bar graph to answer the questions.

Month	Sunny Days
April	
May	
June	
July	
August	
September	

= 3 sunny days

1. How many days were sunny in May? _____
2. How many days were sunny in July? _____
3. Which month had the MOST sunny days? _____
4. Which month had the LEAST sunny days? _____
5. Which two months had the same number of sunny days? _____

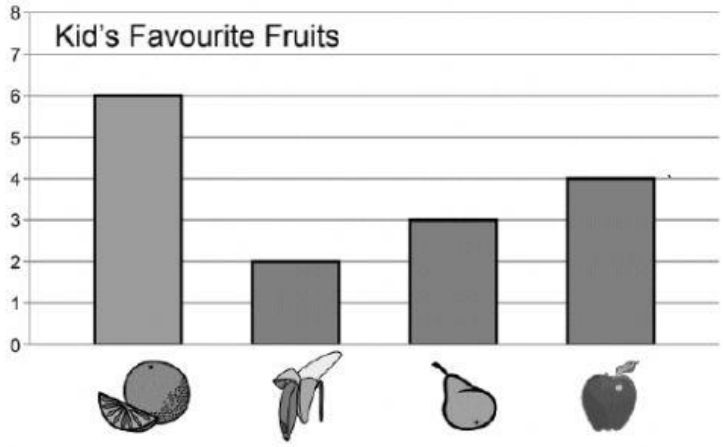

How many kids liked apples ? _____

Which fruit did the most kids like ? _____

Which fruit did the kids like the least ? _____

How many kids liked bananas? _____

How many kids liked either pears or bananas? _____

How many kids liked either oranges or apples? _____

LIVEWORKSHEETS