FINDING MISSING LENGTHS USING PERIMETER

REMEMBER

1. To find the length of the side of a square – Perimeter ÷ 4.

2. To find the missing length in a rectangle when we have the perimeter and width or length –
   - Step 1 Multiply the width or length x 2.
   - Step 2 Subtract the total from the perimeter.
   - Step 3 Divide the answer by 2.

Now do these.

1.

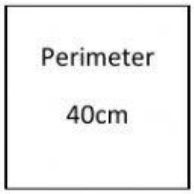

Calculate the length of 1 side of the square.

2.

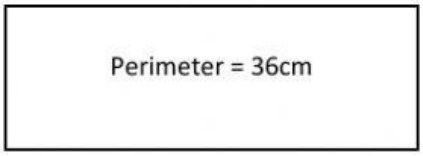

The width is 5cm. Find the length.

3.

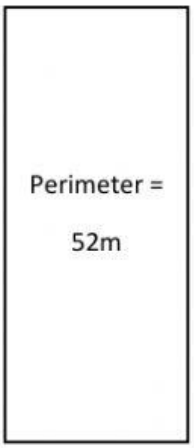

The length is 16cm. What is the width?

LIVEWORKSHEETS

4.

Perimeter =

56m

What is the length of 1 side?

5.

Perimeter = 60m

The width is 9m. Find the length.

6.

Perimeter =

92cm

How long is the side in this square?

LIVEWORKSHEETS