Name: _____ Year 1Bijak

Thursday 10th March 2022

*Chapter 5 - Numbers to 20*

## Topic: Counting in 2s

1.) Find the missing numbers.

(a)

(b)




(c)




2.) Complete the number patterns.

(a) 10 — 12 — ☐ — 16 — ☐

(b)

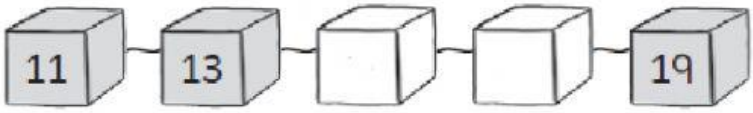


LIVEWORKSHEETS

3.) Look at the numbers below.

Fill in the blanks.

(a) 17 is 2 more than 15.

(b) 18 is 2 less than 20.

(c) _____ is 2 more than 17.

(d) _____ is 2 less than 17.

(e) 2 more than 17 is 19.

(f) 2 less than 19 is 17.

(g) 2 more than 18 is _____.

(h) 2 less than 17 is _____.

(i) _____ is the greatest number.

(j) _____ is the smallest number.

LIVEWORKSHEETS