1. Write the order of the days of the week.

Sunday	7
Wednesday	
Tuesday	
Saturday	
Monday	
Thursday	
Friday	

2. Select the month that comes **before** or **after**.

Which month is **before** September?	August	June	March
Which month is **after** June?	January	August	July
Which month is **before** March?	February	April	July
Which month is **after** October?	December	January	November

3. Select the equivalent unit of time.

1 day = 24 hours	1 week = _____
1 hour = _____	1 week = _____
1 minute = _____	1 year = _____

LIVEWORKSHEETS

4. Use the calendar to answer the questions.

June

M	T	W	T	F	S	S
		1	2	3	4	5
6	7	8	9	10	11	12
13	14	15	16	17	18	19
20	21	22	23	24	25	26
27	28	29	30			

What is the first Friday in June?	3rd
What is the second Saturday in June?	
What is the fourth Tuesday in June?	
What is the third Monday in June?	

5. Write the date circled on the calendar.

November

M	T	W	T	F	S	S
1	2	3	4	5	6	7
8	9	10	11	12	13	14
15	16	17	18	19	20	21
22	23	24	25	26	27	28
29	30					

Example: Friday 16th March

_____ _____ _____

(Day) (Date) (Month)

6. Match the analogue to the digital times.

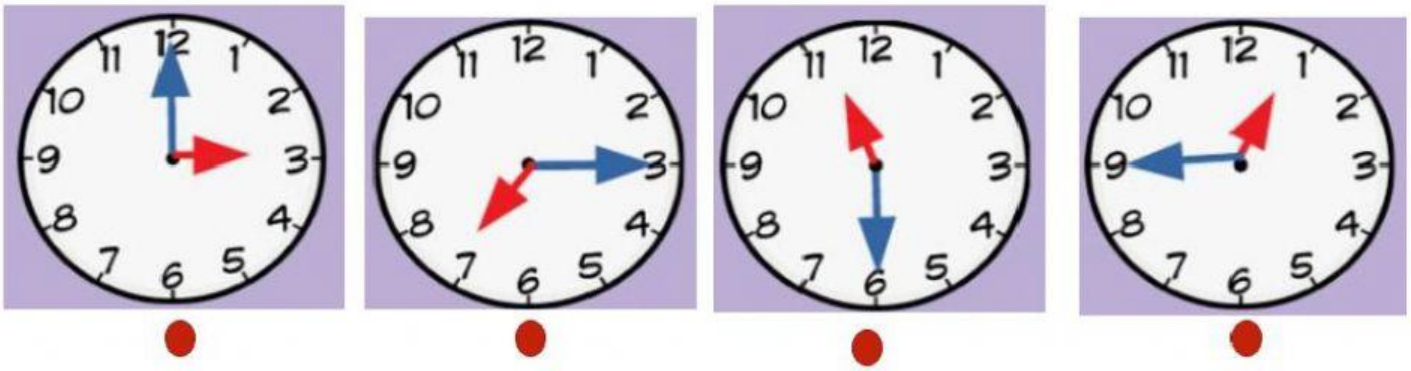

12:45 11:30 03:00 07:15

LIVEWORKSHEETS

6. Match the analogue clocks to the written times.

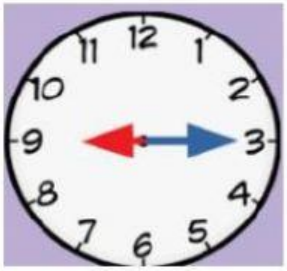

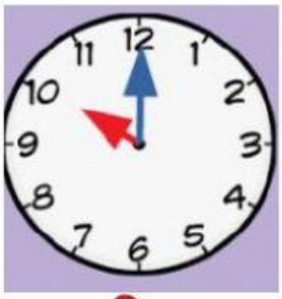

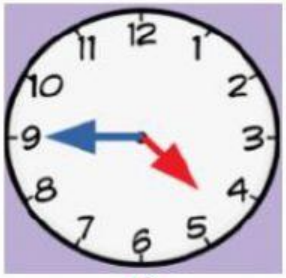

It´s ten o´clock.

It´s a quarter past nine.

It´s half past six.

It´s a quarter to five.

7. Select the correct time of day for each activity.

Lunchtime Midday	Morning Afternoon Evening	Home time 3:30pm	Morning Afternoon Evening
Bedtime 7:30pm	Morning Afternoon Evening	Breakfast 8:00am	Morning Afternoon Evening

LIVEWORKSHEETS

7. Select the correct digital time for the time shown on the analogue clocks.

4:04	4:20	3:40

2:30	2:45	2:15

5:25	5:30	6:05

5:35	7:25	7:12

LIVEWORKSHEETS