ÁLGEBRA **TEMA:** Producto de un monomio por un polinomio

Arrastra la expresión que representa el área sombreada de cada figura y luego arrastra el resultado de la multiplicación correspondiente al área sombreada de cada figura.

Expresión	Representación	Multiplicación
	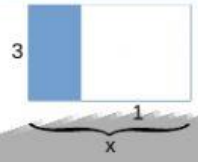	
	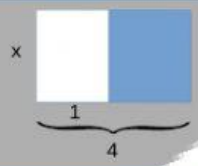	
	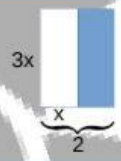	
	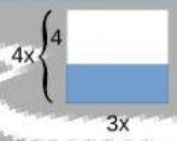	
	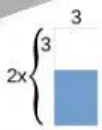	

Expresión		Multiplicación	
$3(x-1)$	$x(4-1)$	$6x-3x^2$	$12x^2-12x$
$3x(2-x)$	$(2x-3)\cdot 3$	$3x-3$	$4x-x$
$(4x-4)3x$	$4\cdot 3x-1\cdot 2x$	$6x-9$	$12x-2x$

LIVEWORKSHEETS