Final Exam **Semester 2** Academic Year 2021 Grade Level: **P 4/1**
Group learning: Foreign Language Subject: **Math** No. of Questions: **20** No. of Points: **20**
Watpangiw School Under the Pathumthani Provincial Administrative Organization

---

Name: _____ **Student's No.:** _____**Level/Class:** __P4/1__

I. Multiple Choice. Choose the letter of your answer. (20 points)

1) _____ is a part of a whole. It consists of **numerator and denominator**.

a. Decimal **b.** Division **c.** Fraction **d.** Geometry

2) _____ is a number whose whole number and fractional part are **separated with decimal point**.

a. Decimal **b.** Division **c.** Fraction **d.** Geometry

3) Which of the following is a **proper fraction**?

a. $\frac{3}{5}$ **b.** $1\frac{1}{5}$ **c.** $\frac{9}{5}$ **d.** $\frac{11}{7}$

4) Which of the following is an **improper fraction**?

a. $\frac{2}{7}$ **b.** $\frac{1}{2}$ **c.** $\frac{15}{6}$ **d.** $3\frac{1}{4}$

5) Which of the following is a **mixed number**?

a. $\frac{1}{6}$ **b.** $\frac{5}{7}$ **c.** $1\frac{3}{8}$ **d.** $\frac{9}{5}$

6) Find the missing number in a pair of **equivalent fractions** $\frac{4}{9} = \frac{20}{\square}$.

a. 30 **b.** 35 **c.** 40 **d.** 45

7) Which fraction is the **greatest**?

a. $\frac{2}{15}$ **b.** $\frac{2}{13}$ **c.** $\frac{2}{11}$ **d.** $\frac{2}{7}$

8) Which of the following is a set of fractions **from the least to the greatest**.

a. $\frac{2}{4}, \frac{2}{7}, \frac{2}{10}, \frac{2}{2}$ **b.** $\frac{2}{2}, \frac{2}{4}, \frac{2}{10}, \frac{2}{7}$ **c.** $\frac{1}{9}, \frac{3}{9}, \frac{5}{9}, \frac{9}{9}$ **d.** $\frac{9}{9}, \frac{5}{9}, \frac{3}{9}, \frac{1}{9}$

LIVEWORKSHEETS

9) Which of the following figures are **rectangles**?

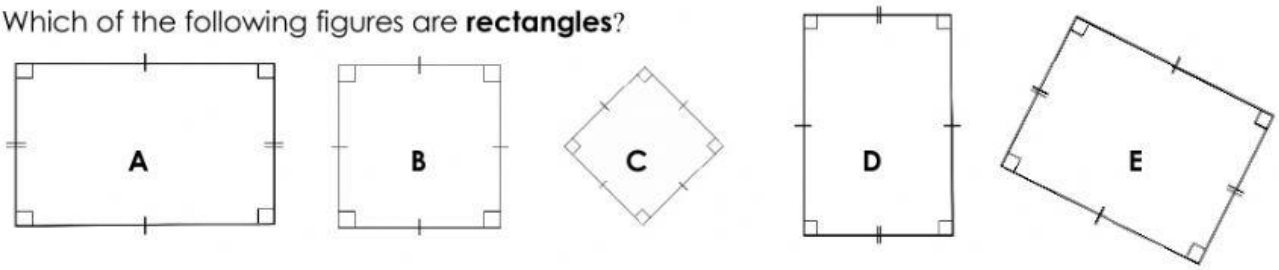

a. A, B and D **b.** B and C **c.** A, B and C **d.** A, D and E

10) Which of the following statements is **correct** about a **square**?

a. It has 3 equal sides and 3 angles. **b.** It has 4 equal sides and 4 right angles.

c. It has 1 pair of parallel sides. **d.** It has 6 lines of symmetry.

11) Which of the following is **not a quadrilateral?**

a. parallelogram **b.** rectangle **c.** trapezium **d.** triangle

---

12) How many **lines of symmetry** does the figure have?

a. 0 **b.** 1 **c.** 2 **d.** 4

13) How many **lines of symmetry** in the figure?



a. 0 **b.** 1 **c.** 2 **d.** 3

---

14) _____ is one of the **radius/radii** of the circle.

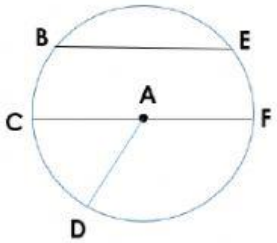

a. Point A **b.** $\overline{AD}$ **c.** $\overline{BE}$ **d.** $\overline{CF}$

15) _____ is the **diameter** of the circle.

a. Point A **b.** $\overline{AD}$ **c.** $\overline{BE}$ **d.** $\overline{CF}$

LIVEWORKSHEETS

Items 16 – 18)

Favourite Sports

Sport	Number of Students
Badminton	10
Basketball	25
Table tennis	8
Swimming	12
Gymnastics	5

16) What is the **most** favourite sport**?**

a. Badminton **b.** Basketball **c.** Swimming **d.** Table tennis

17) What is the **least** favourite sport**?**

a. Badminton **b.** Basketball **c.** Gymnastics **d.** Table tennis

18) How many students are there in **total?**

a. 58 **b.** 60 **c.** 61 **d.** 70

Items 19 – 20)

Jake recorded the number of pizzas sold over five days.
Read the chart and answer the questions.

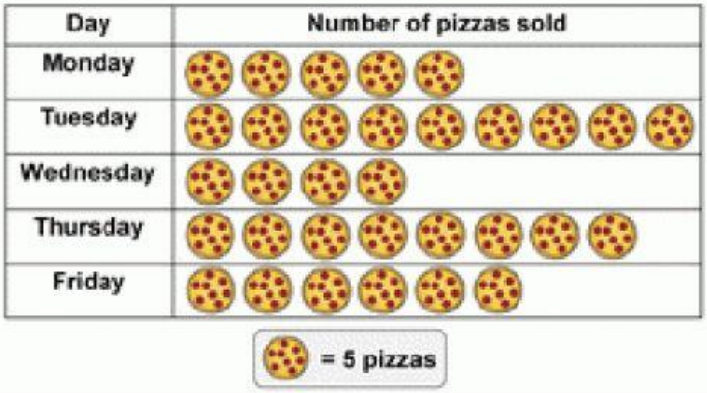

19) How many pizzas did Jake sell on **Thursday?**

a. 8 **b.** 40 **c.** 80 **d.** 100

20) How many pizzas did Jake sell **in 5 days?**

a. 60 **b.** 80 **c.** 150 **d.** 160

LIVEWORKSHEETS