Name: .....

Class: ..... Date: .... /..../.....

# WORKSHEET – GRADE 3

## MATHS – Revision for Midterm test 2

***Teacher's comments:*** .....

.....

**I, CHOOSE THE BEST ANSWER.**

1, Which **multiplication** sentence is represented by this array?



**A.** $4 \times 5$ **B.** $6 \times 6$ **C.** $5 \times 6$ **D.** $5 + 6$

2, Calculate:

24 **multiplied by** 10 equals .....

**A.** 240 **B.** 204 **C.** 2410 **D.** 34

3, Which **multiplication** sentence is represented by this array?



**A.** $6 \times 4$ **B.** $12 \times 2$ **C.** $4 \times 4$ **D.** $12 + 12$

3, A bakery has 9 cakes. If each cake is cut into 8 slices, how many slices of cake are there altogether?

**A.** 17 slices **B.** 72 slices **C.** 1 slice **D.** 98 slices

4, 5, Fill in the blank:

... **times** 7 equals 42

**A.** 9 **B.** 8 **C.** 7 **D.** 6



LIVEWORKSHEETS

6, What shape is this?

**A.** Cylinder **B.** Cuboid **C.** Cube **D.** Cone

7, I am a 2D-shapes. I have 8 vertices and 8 sides. What am I?

**A.** Pentagon **B.** Hexagon **C.** Octagon **D.** Square

8, How many **curved sides** are there in a rectangle?

**A.** 3 **B.** 1 **C.** 4 **D.** 0

9, What 3D-shape looks like a dice?

**A.** Cuboid **B.** Cone **C.** Cylinder **D.** Cube

10. Compare.

$4 \times 5$ ☐ $2 \times 10$

**A.** $<$ **B.** $>$ **C.** $=$ **D.** $+$

**II, FILL IN THE BLANKS.**

**Question 1**: Given that

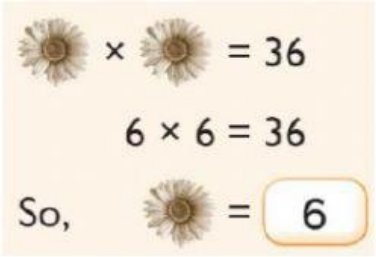


Calculate:

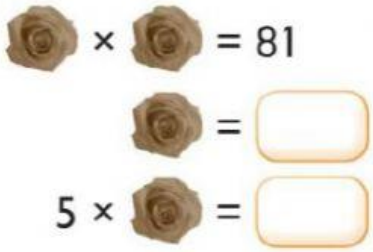


**Question 2:** A rabbit has four legs. There are seven rabbits in the garden. How many rabbit legs are there altogether?

**Answer:** _____ legs.

**Question 3:** What number comes next?

1, 2, 4, 8, 16, ...

**Answer:** _____


LIVEWORKSHEETS

**Question 4:** The bar graph below shows the number of storybooks read by Padma, Jade, Samir and Han in a week.

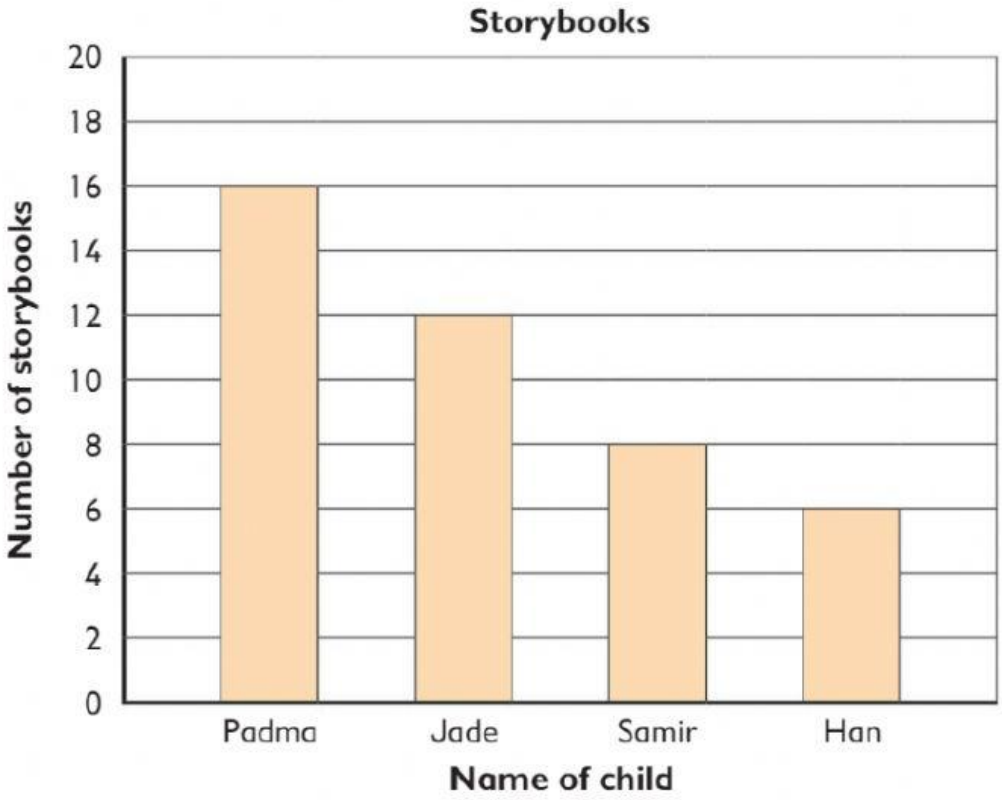


1. Who read the most storybooks?

**Answer:** _____

2. Who read the fewest storybooks?

**Answer:** _____

3. How many storybooks does Samir read?

**Answer:** _____ storybooks.

4. How many fewer storybooks did Samir read than Jade?

**Answer:** _____ storybooks.

5. How many storybooks did the children read altogether?

**Answer:** _____ storybooks.

6. Who read more than 12 storybooks?

**Answer:** _____


LIVEWORKSHEETS