ICHTHUS SCHOOL

Name:_____ Class: 2_____ Date: _____

MASS

Write the mass of the items below.

1.

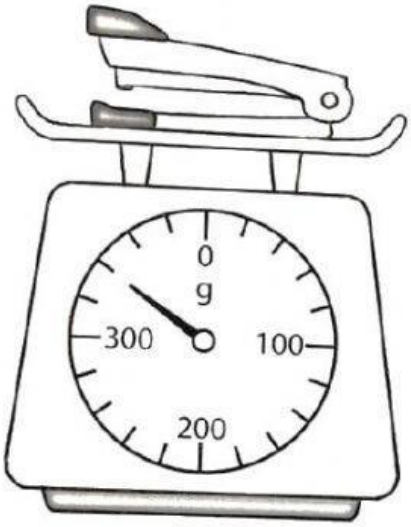

_____g

2.

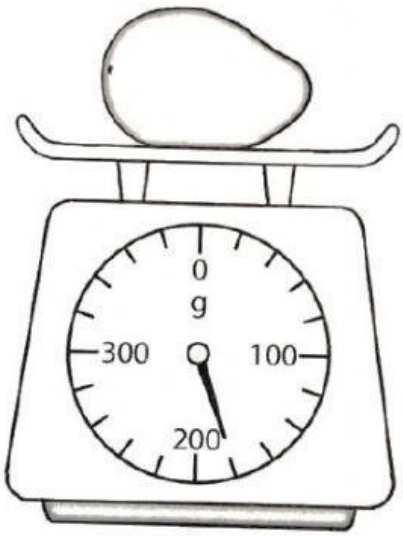

_____g

3.



_____g

4.



_____g

LIVEWORKSHEETS

5.

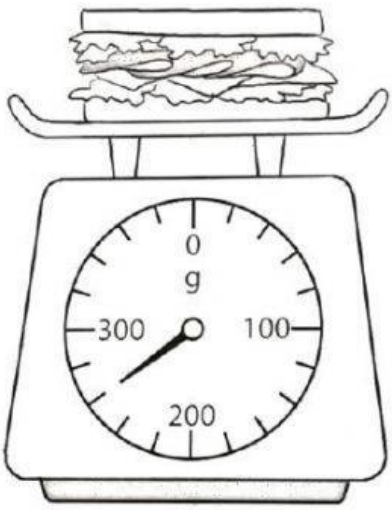

_____ g

6.

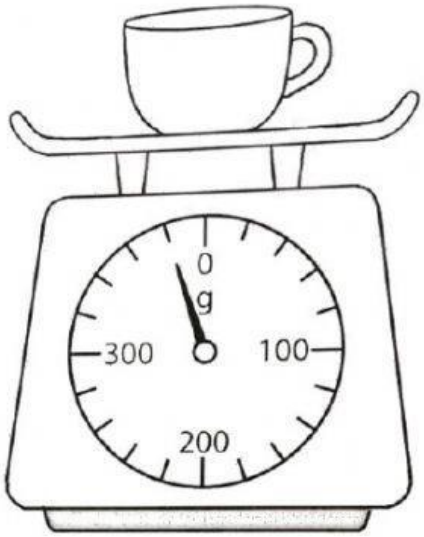

_____ g

7.



_____ g

8.



_____ g

LIVEWORKSHEETS

Look at the balances and answer the questions below.

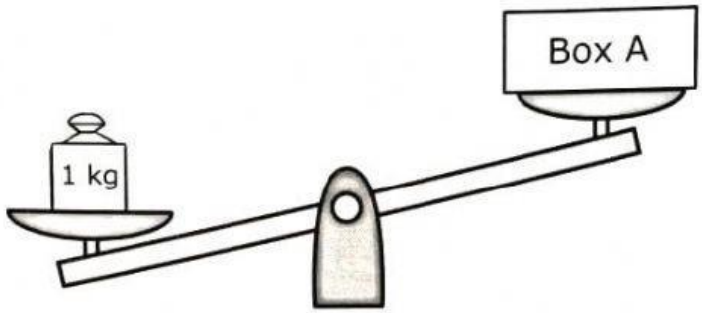

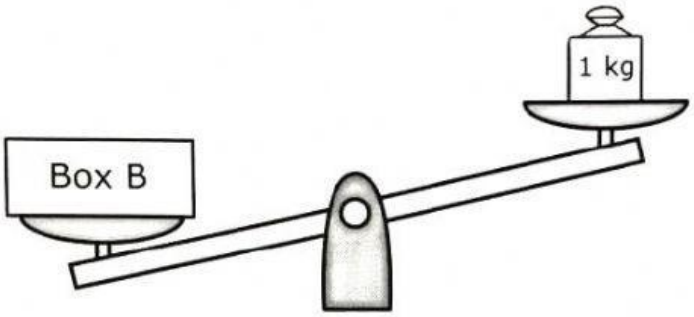

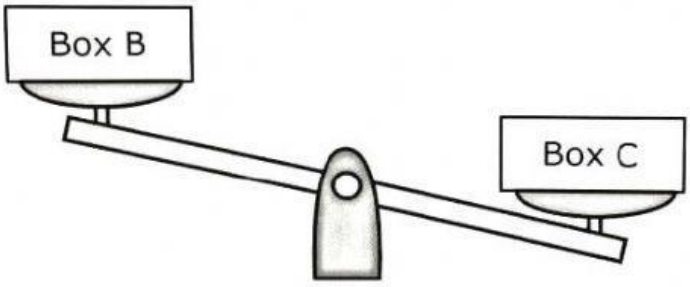

Fill in the blanks with **more than** or **less than**.

(a) The mass of Box A is _____ 1 kg.

(b) The mass of Box B is _____ 1 kg.

Fill in the blanks with the correct letters.

(c) Box B is lighter than Box _____.

(d) Box B is heavier than Box _____.

(e) Box _____ is the lightest.

(f) Box _____ is the heaviest.

LIVEWORKSHEETS