Write the name of each shapes.

1. _____

2. _____

3. _____



4. _____

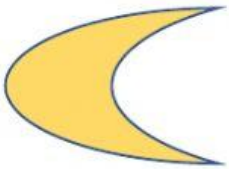

5. _____

6. _____

7. _____

8. _____

9. _____



10. _____

LIVEWORKSHEETS