NÚMEROS DECIMALES

1.- Escribe la parte sombreada en <u>forma decimal</u>.



a)



b)



c)

d)



e)



f)



g)



h)



i)



j)

2.-¿Qué número es?

a) 7 D + 2 U + 5 d + 9 c →

b) 4 U + 3 d + 1 c →

c) 6 D + 2 d + 4 c →

d) 8 D + 5 U + 3 c →

e) 4 U + 8 d + 7 c →

f) 1 D + 1 c →

g) 5 d + 6 c →

h) 9 D + 9 d →

3.- Escribe con cifras.

a) Quince coma cuarenta y dos →

b) Cinco unidades y una centésima →

c) Ochenta coma treinta y seis →

d) Dos unidades y ocho décimas →

e) Tres unidades y una décima →

f) Veinte coma noventa y cinco →

g) Doce coma cero nueve →

h) Nueve unidades y dos décimas →

5.- Sitúa en esta recta númerica de los siguientes números:

A = 6,3 B = 5,8 C = 7,1 D = 6,5 E = 3,9

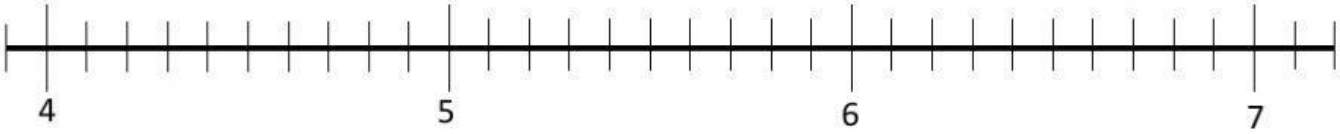

6.- Indica a qué número corresponde cada letra en la recta.
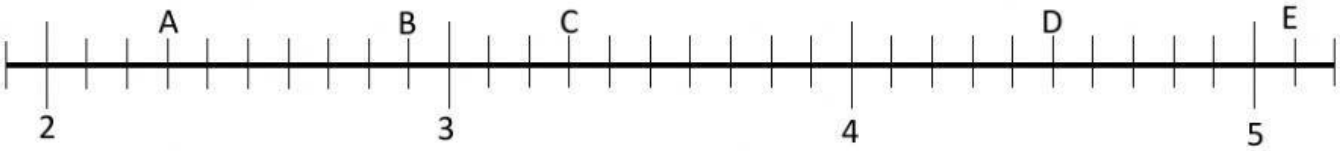
A = B = C = D = E =