1. Fill in the blanks.

(a)

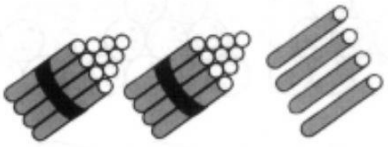

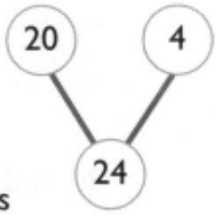

24 = _____ tens _____ ones

2. Write the numbers.

(a) 4 tens 9 ones = _____

3. Write the numbers.

(a) Forty-six

(b) Sixty-seven

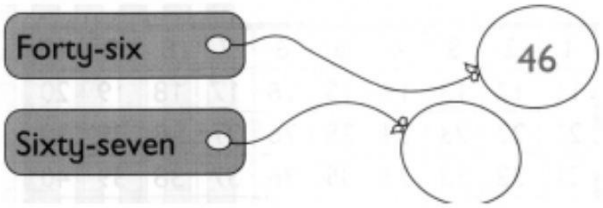

4. Write the numbers in words.

(a) 50 _____

(b) 64 _____

---

1. Write the numbers between 32 and 42.

32, ___, ___, ___, ___, ___, ___, ___, ___, ___, 42

3. Circle the greater number.

(a) 65 75 (b) 20 50

(c) 98 88 (d) 63 36

5. Fill in the blanks.

(a) 1 more than 76 is _____.

(b) 1 less than 76 is _____.

(c) 20 more than 76 is _____.

(d) 20 less than 76 is _____.

(e) 10 less than 86 is _____.

(f) 20 less than 94 is _____.

Write the missing numbers.

(a)

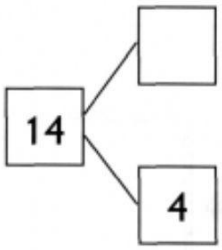

(b)

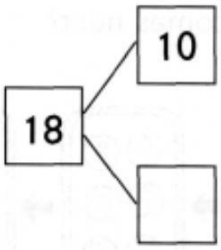

LIVEWORKSHEETS