Los triángulos

		SEGÚN SUS ÁNGULOS		
		ACUTÁNGULOS Tres ángulos agudos.	**RECTÁNGULOS** Un ángulo recto.	**OBTUSÁNGULOS** Un ángulo obtuso.
SEGÚN SUS LADOS	**EQUILÁTEROS** Tres lados iguales.		No existe.	No existe.
	ISÓSCELES Dos lados iguales.			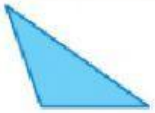
	ESCALENOS Tres lados desiguales.	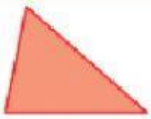		

Clasifica estos triángulos según sus lados y según sus ángulos

A



B



C

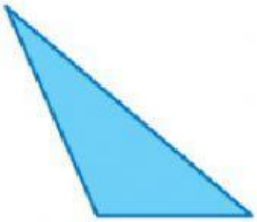

D


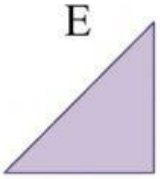
E