School name……

Student Name……Student No……Class ……

REF02004 Determine the basic operating conditions of domestic air conditioning systems

Match between the chart suitable property to it:

Chart	property
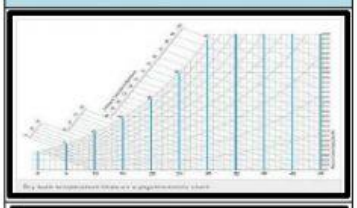	Specific enthalpy
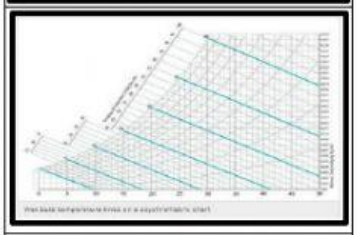	Humidity ratio
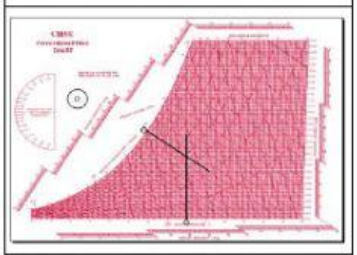	Relative humidity
	Dew point temperature
	Wet bulb temperature
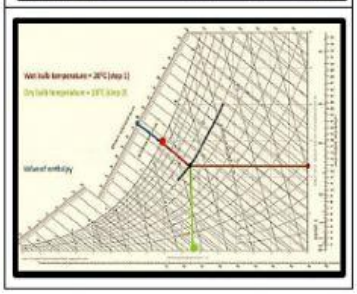	Dry bulb temperature

LIVEWORKSHEETS