What's the Volume

Name: _____ Class: _____

Calculate the volume of each cuboid

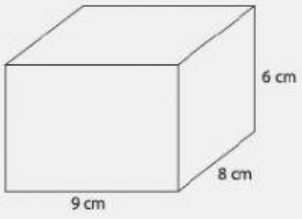

Volume: cm^3

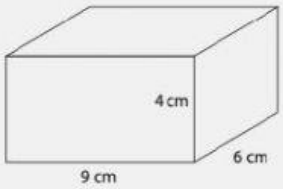

Volume: cm^3

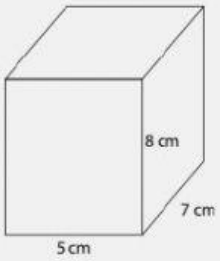

Volume: cm^3

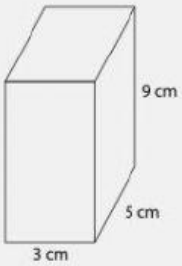

Volume: cm^3

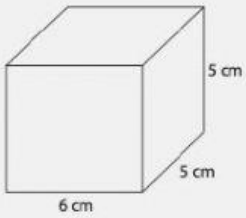

Volume: cm^3

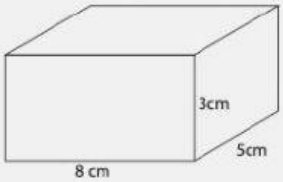

Volume: cm^3

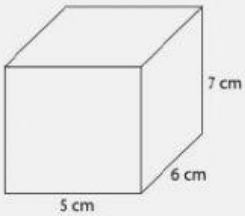

Volume: cm^3

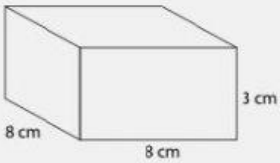

Volume: cm^3

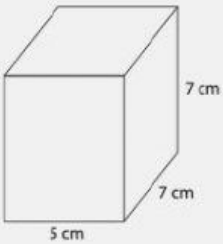

Volume: cm^3

LIVEWORKSHEETS
LIVEWORKSHEETS