Practice 1

Counting Air transportations

Drag the correct number according to the numbers of the objects.

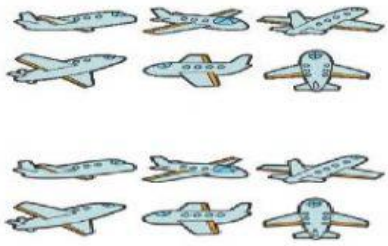	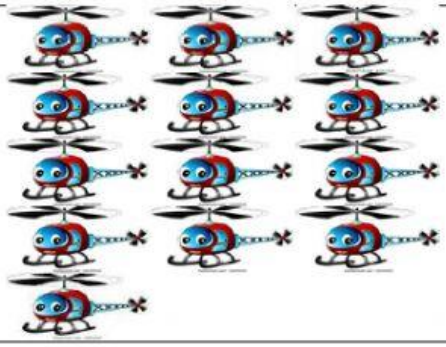	
15	12	13

Counting water transportations

Drag the correct number according to the numbers of the objects.

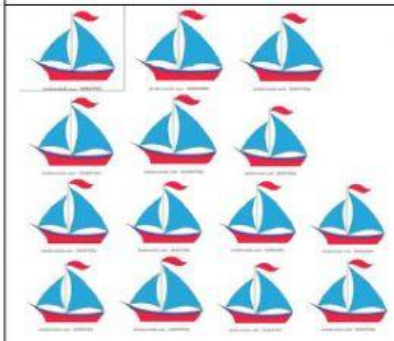		
11	14	10

Listen to the number and choose the correct one:

	10	11	12	13	14	15
	10	11	12	13	14	15
	10	11	12	13	14	15
	10	11	12	13	14	15
	10	11	12	13	14	15

LIVEWORKSHEETS