CAMAMAN-AN ELEMENTARY SCHOOL

Q3 MATH Learning Activity Sheet#2

DepED DEPARTMENT OF EDUCATION K TO 12 PROGRAM

NAME: _____ SCORE: _____

GRADE & SECTION: _____ PARENT'S SIGNATURE: _____

TEACHER: _____

Itandi ang pagkabahin nga pahayag sa lumbay A ngadto sa hulagway sa lumbay B. E-konek kini sa letra sa insaktong tubag.

A		B
1. 6÷ 3 = 2	A.	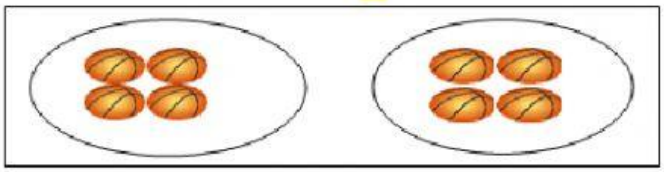
2. 8 ÷ 2 = 4	B.	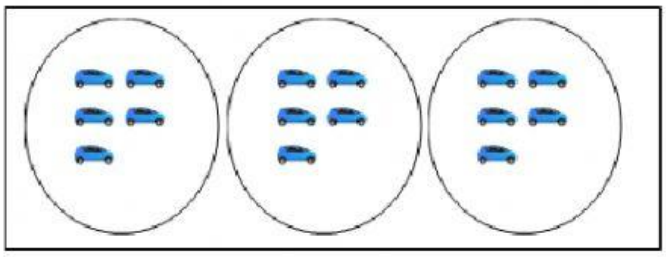
3.10 ÷ 2 = 5	C.	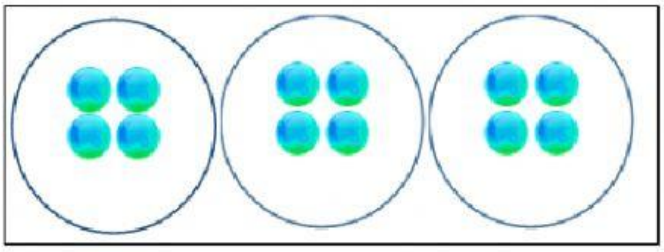
4. 12 ÷ 3 = 4	D.	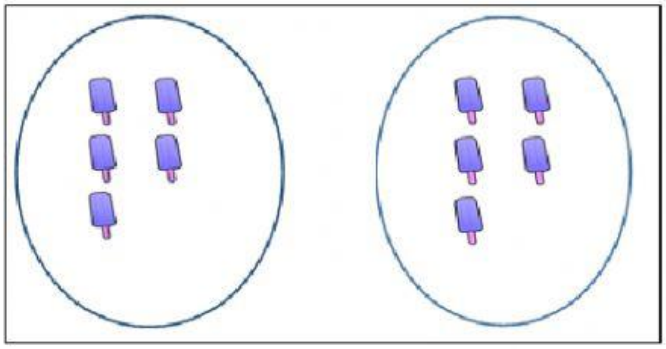
5. 15 ÷ 3 = 5	E.	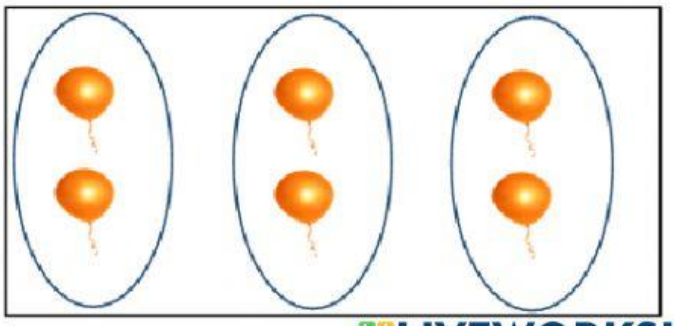

LIVEWORKSHEETS