NOMBRE DEL ALUMNO: _____

ACTIVIDAD 1. OBTÉN LAS DIMENSIONES QUE SE TE PIDEN EN CADA UNO DE LOS SIGUIENTES EJERCICIOS.
(NOTA: Tus resultados trúncalos hasta décimas, es decir 11.5)

W = cm
t = cm
x = cm
y = cm

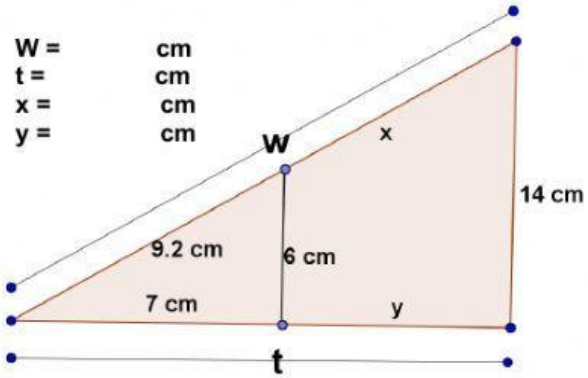

W = cm
t = cm
x = cm
z = cm

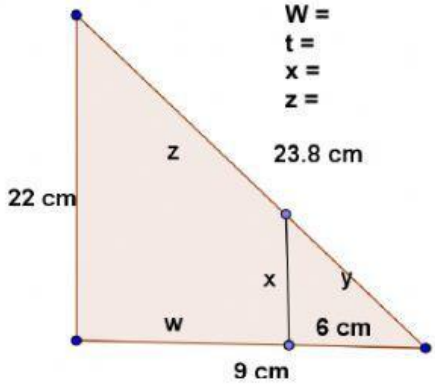

x = cm
y = cm

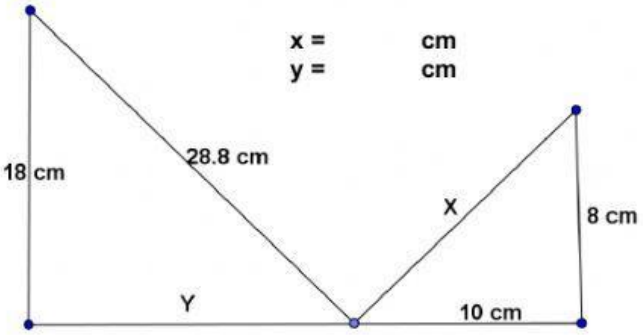

x = cm
y = cm

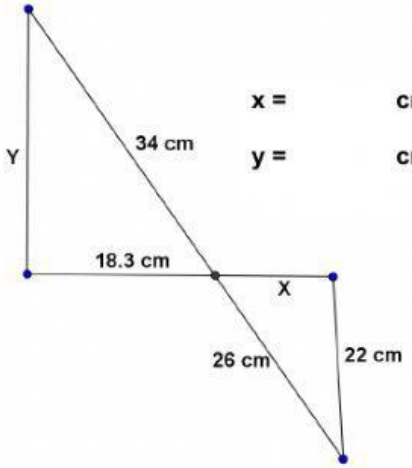

s = cm
t = cm
w = cm
x = cm
y = cm
z = cm

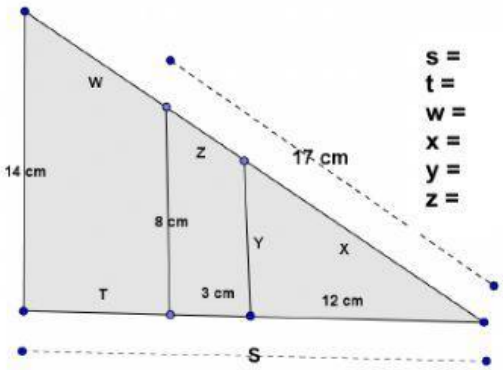

s = cm
t = cm
w = cm
x = cm
y = cm
z = cm

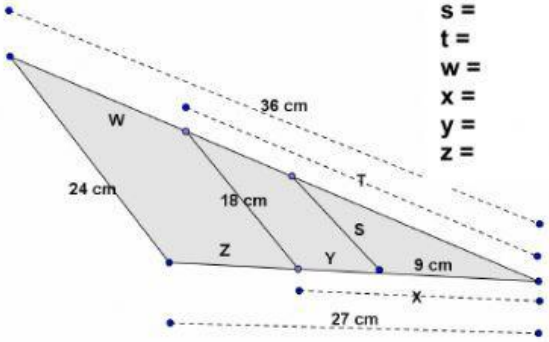

LIVEWORKSHEETS