ITINERARI 14: PERÍMETRES

Calcula els perímetres de les següents figures:

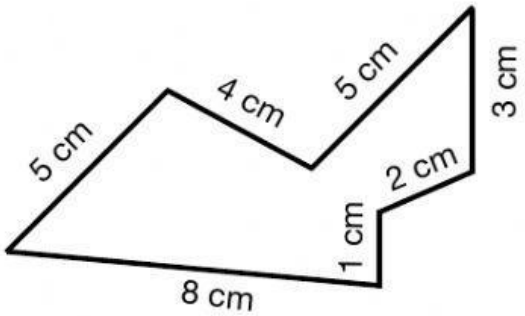

Perímetre: ……. cm

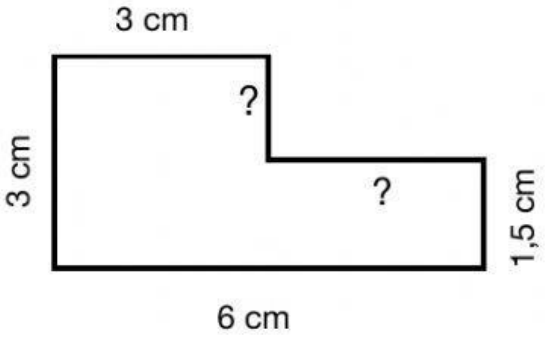

Perímetre: ……. cm

Perímetre: ……. cm

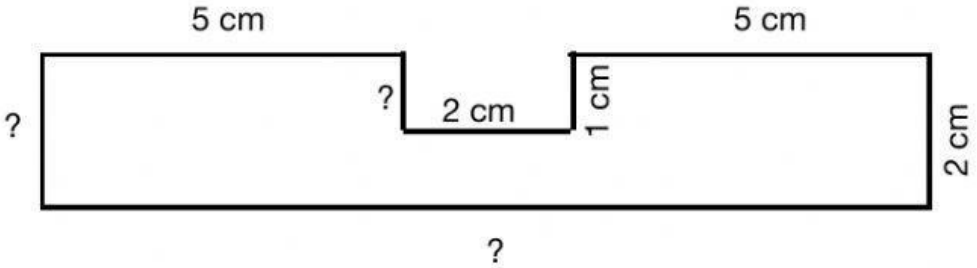

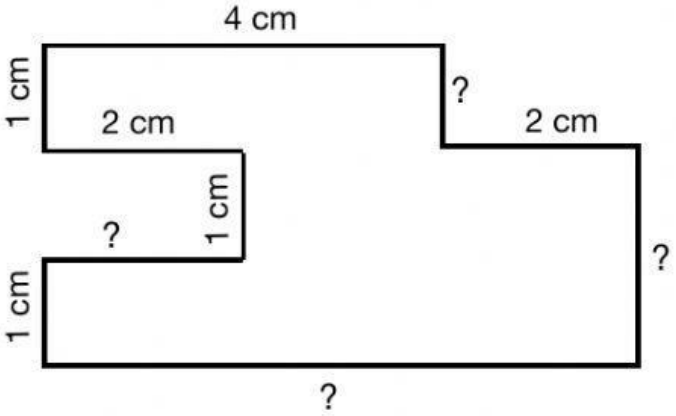

Perímetre: ……. cm

LIVEWORKSHEETS

quadrat



3 cm

Perímetre: ……. cm

triangle equilàter

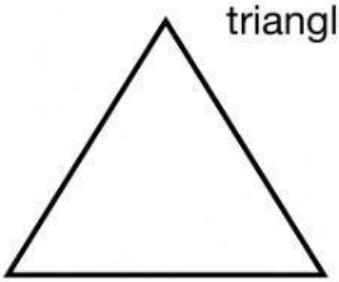

2,5 cm

Perímetre: ……. cm

2 cm

paral·lelogram (rectangle)

4,5 cm

Perímetre: ……. cm

1,5 cm

polígon (hexàgon).

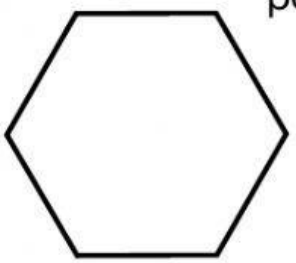

Perímetre: ……. cm

LIVEWORKSHEETS