Topic : Living Things (General Science)

CLASSWORK # 2

1. Label the following animal cell.

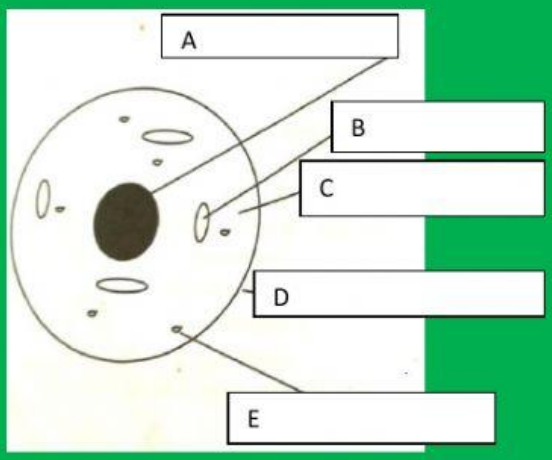

2. Write the letter of the structure from the diagram that matches with the following statements.

a. Contains chromosomes ☐

b. controls what enters & exit the cell ☐

c. Jelly-like substance in the cell ☐

d. carries out cellular respiration ☐

e. controls and coordinates the activities of th cell. ☐

f. provides the cell with energy ☐

g. It stores food. ☐

h. site where all the cell reactions take place ☐

2. Label the plant cell diagram below:

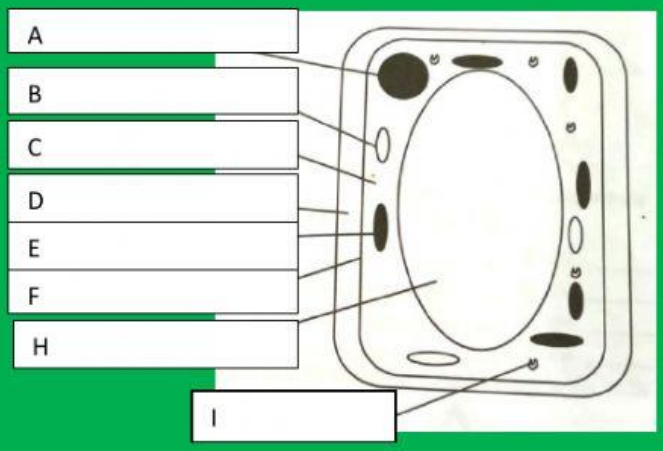

3. Name three structures that are found in animal cell but not in plant cell.

_____

_____

_____

4. Write the letter of the plant cell structure diagram that matches with the following statement

____stores food ____site of photosynthesis _____stores cell sap and nutrients

____gives cells shape and rigidity _____made of cellulose

5. Name the characteristics of living things to match the following statements:

_____a. the ability to increase in size and complexity

_____b. Ability to feed

_____c. The ability to release energy from foods

_____d. The ability to respond to stimuli

LIVEWORKSHEETS

6. Identify the cells below:

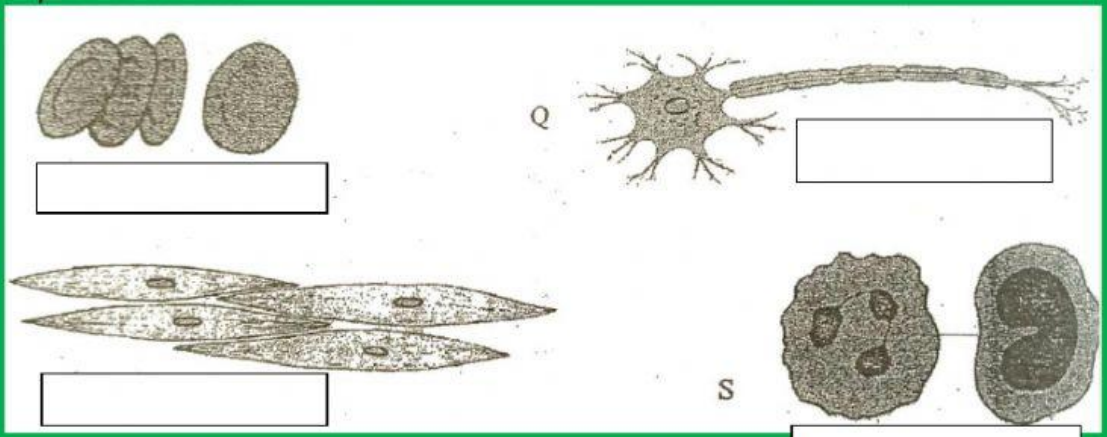

7. Provide the functions of the following cells:

a. nerve cell _____

b. sperm cell_____

c. red blood cell_____

d. muscle cell_____

e. white blood cell_____

LIVEWORKSHEETS